MATEMATIK TAHUN 3

UNIT 1: TEROKA NOMBOR

A) Padankan kuantiti bagi yang gambarajah berikut.

1.

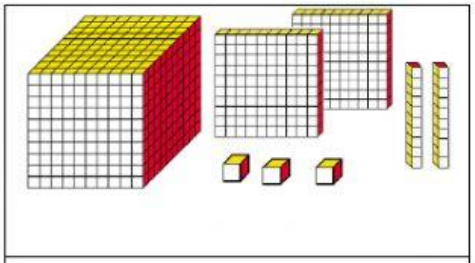

2 312

2.



5 360

3.

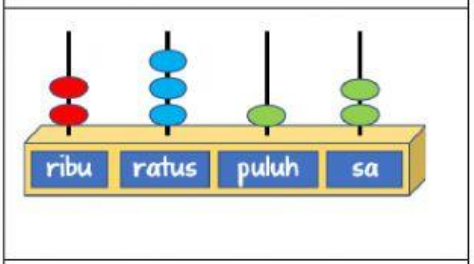

1 223

4.

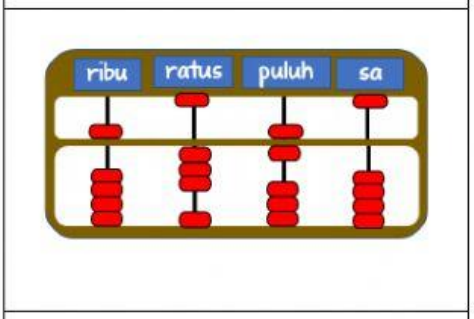

3 000

5.

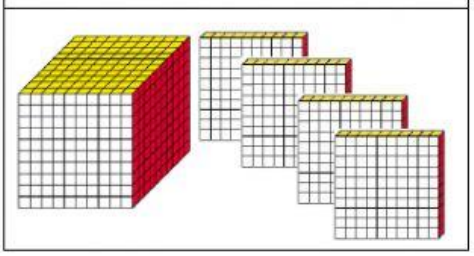

1 400

LIVEWORKSHEETS

B) **Tandakan (√) pada nilai nombornya yang betul.**

6.	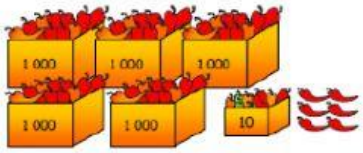	5 016	
		5 106	

7	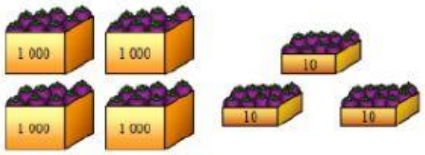	4 300	
		4 030	

8.	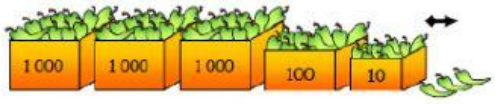	3 113	
		3 100	

9.	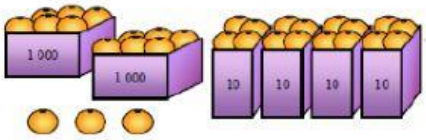	2 403	
		2 043	

10.	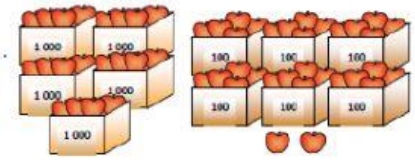	5 620	
		5 602	

LIVEWORKSHEETS