LIVEWORKSHEETS

FRACCIONES IMPROPIAS Y NÚMERO MIXTO

1 **Escribe la fracción que representa la parte coloreada. Después, expresa esa fracción en forma de número mixto.**

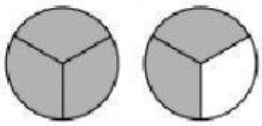

$\frac{5}{3} = 1\frac{2}{3}$

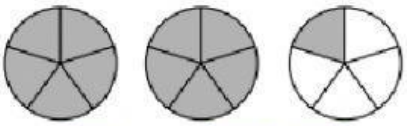

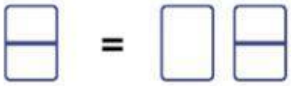





2 **Colorea la fracción que se indica y escríbela en forma de número mixto.**

$\frac{5}{3}$ ▶



$\frac{13}{5}$ ▶

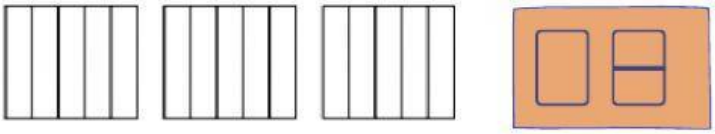

$\frac{15}{4}$ ▶

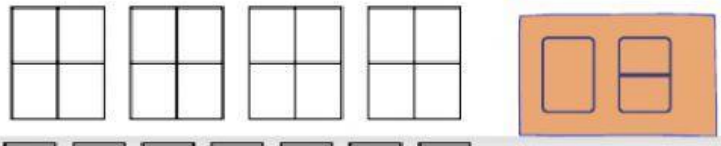

$\frac{13}{2}$ ▶

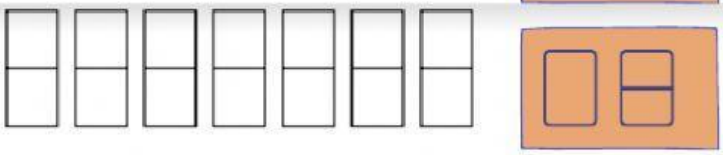

3 **Completa.**

- $1\frac{2}{3} = \frac{5}{3}$
- $2\frac{1}{2} = __$
- $3\frac{2}{3} = __$
- $4\frac{1}{2} = __$
- $1\frac{4}{5} = __$
- $2\frac{3}{4} = __$
- $3\frac{1}{5} = __$
- $4\frac{2}{6} = __$

REPASA ESTA INFORMACIÓN. Después, corrige tus actividades.

- Un número mixto está formado por un número natural y una fracción.
- Todas las fracciones mayores que la unidad que no son equivalentes a un número natural se pueden expresar en forma de número mixto.

LIVEWORKSHEETS