Nama Kelompok :

Kelas : .....

Perbandingan Ukuran

Perhatikan gambar di bawah ini. Tuliskan angka 1, 2, 3 pada urutan ukuran benda dari pendek ke panjang.

Contoh :

1

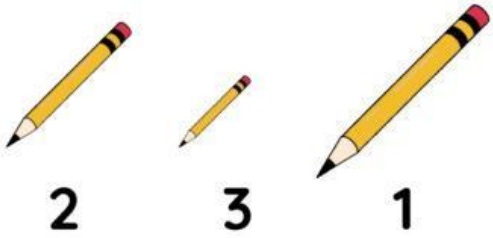

2

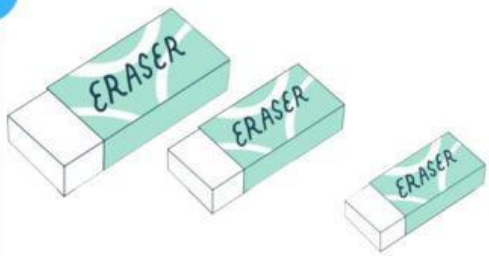

3

4

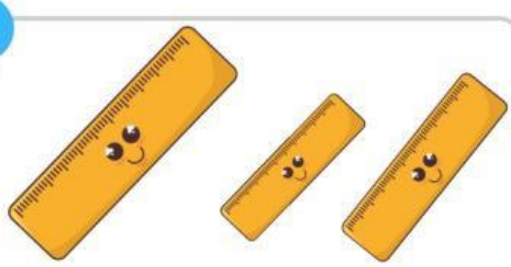

5



6

7



8

LIVEWORKSHEETS

Nama:_____

Pengukuran Panjang

Dengan menggunakan penggaris di bawah, ukur setiap krayon dan tuliskan panjangnya pada garis di dalam krayon.

LIVEWORKSHEETS