Točka. Pravac. Ravnina.

1 Poveži sliku geometrijskog pojma s njegovim nazivom.

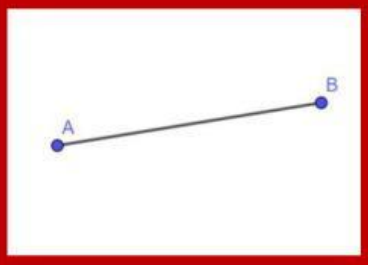

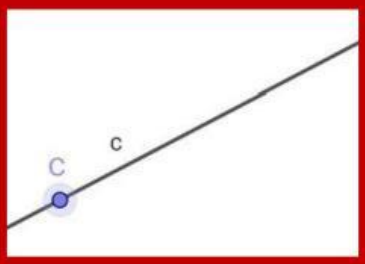



pravac polupravac dužina

2

Točke označavamo , , slovima.

Pravce označavamo , , slovima.

Ravnine označavamo , slovima.

3 Za svaku sliku označi jesu li točke kolinearne ili nekolinearne.

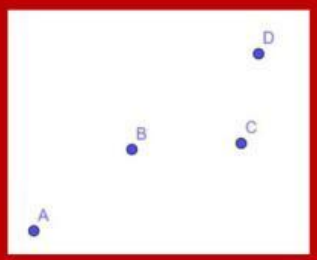

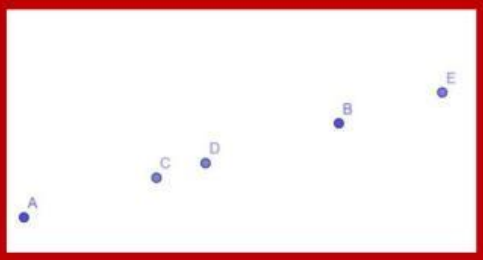

4 Dopuni rečenice za svaku sliku.

Pravci se .



Pravci su .

Pravci se .

LIVEWORKSHEETS