ACADEMIA 3D

GEOMETRÍA

Superficie de Figuras Geométricas Circulares y Semicirculares

Luis Enrique Lazo Vásquez 933505841

1.- Calcula el área de la región circular.

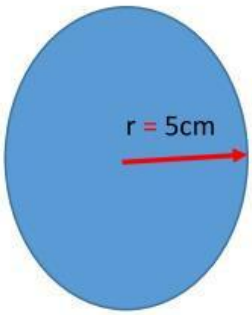

$$A_o = \pi . r^2$$

$$A_o = \pi . (\quad)^2$$

$$A_o = \quad \pi cm^2$$

LIVEWORKSHEETS

2.- Calcula el área de la región circular.

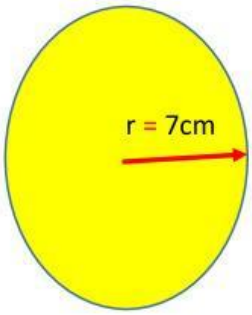

$$A_o = \pi . r^2$$

$$A_o = \pi . (\quad)^2$$

$$A_o = \quad \pi cm^2$$

3.- Calcula el área de la región circular.

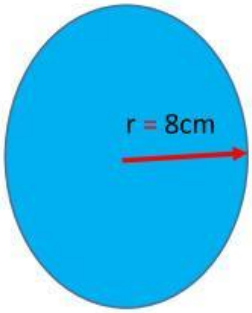

$$A_o = \pi . r^2$$

$$A_o = \pi . (\quad)^2$$

$$A_o = \quad \pi cm^2$$

4.- Calcula el área de la región circular.

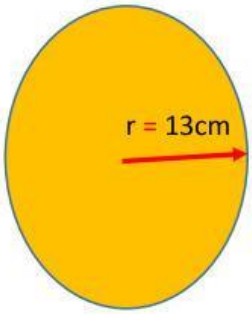

$$A_o = \pi . r^2$$

$$A_o = \pi . (\quad)^2$$

$$A_o = \quad \pi cm^2$$

LIVEWORKSHEETS

5.- Calcula el área de la región circular.

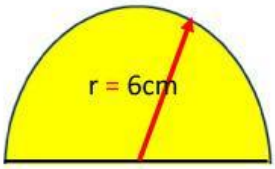

$A_o = \pi.r^2/2$

$A_o = \pi.(\quad)^2/2$

$A_o = \quad \pi/2$

$A_o = \quad \pi\ cm^2$

6.- Calcula el área de la región circular.

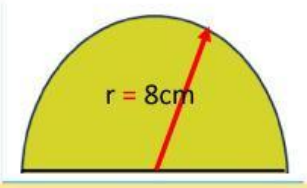

$A_o = \pi.r^2/2$

$A_o = \pi.(\quad)^2/2$

$A_o = \quad \pi/2$

$A_o = \quad \pi\ cm^2$

7.- Calcula el área de la región circular.

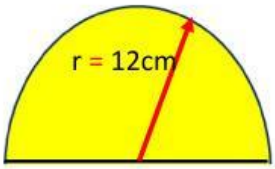

$A_o = \pi.r^2/2$

$A_o = \pi.(\quad)^2/2$

$A_o = \quad \pi/2$

$A_o = \quad \pi\ cm^2$

LIVEWORKSHEETS

8.- Calcula el área de la región circular.

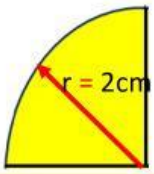

$A_{o/2} = \pi.r^2/4$

$A_{o/2} = \pi.(\quad)^2/4$

$A_{o/2} = \quad \pi/$

$A_{o/2} = \quad \pi\ cm^2$

9.- Calcula el área de la región circular.

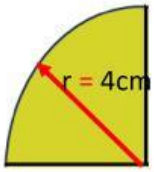

$A_{o/4} = \pi.r^2/4$

$A_{o/4} = \pi.(\quad)^2/4$

$A_{o/4} = \quad \pi/$

$A_{o/4} = \quad \pi\ cm^2$

10.- Calcula el área de la región circular.

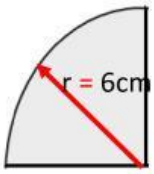

$A_{o/4} = \pi.r^2/4$

$A_{o/4} = \pi.(\quad)^2/4$

$A_{o/4} = \quad \pi/$

$A_{o/4} = \quad \pi\ cm^2$

LIVEWORKSHEETS