Find each measure.

2. $m\angle T$

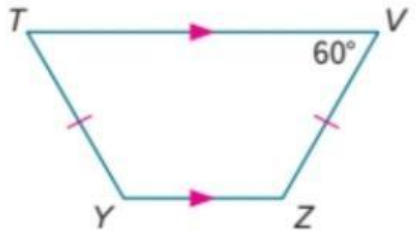

3. $m\angle Y$

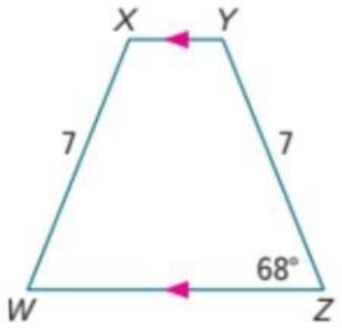

Example 2

LIVEWORKSHEETS

$\overline{TS}$ is the midsegment of trapezoid *HJKL*.

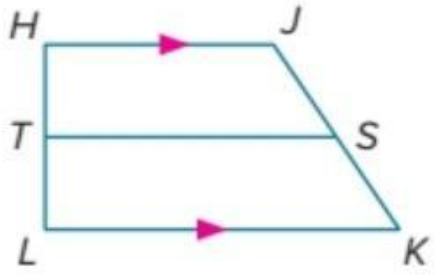

6. If $HJ = 14$ and $LK = 42$, find TS.

7. If $LK = 19$ and $TS = 15$, find HJ.

8. If $HJ = 7$ and $TS = 10$, find LK.

9. If $KL = 17$ and $JH = 9$, find ST.

10. If $TS = 24$ and $LK = 27.4$, find HJ.

LIVEWORKSHEETS