ÉLÉMENTS DE GÉOMÉTRIE

Vocabulaire et notation

.....

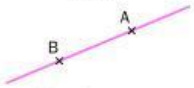

Notation : .....

Segment

E et F sont les .....du segment.
EF est la .....du segment.
Notation du segment: .....

.....

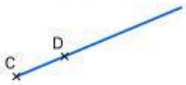

C est l'..... de la demi-droite.
Notation :.....

Points .....

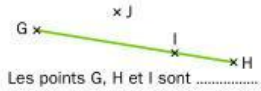

Les points G, H et I sont .....
Notations : I ∈ [GH] signifie
I .....à [GH];
J ∉ [GH] signifie] .....à [GH]

O est le..... de .....

O .....au .....;
et ..... = ...

Propriétés

SI $(d_1) // (d)$ et $(d_2) // (d)$ → **ALORS** (d_1) et ..... sont .....

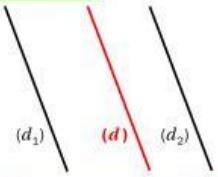

SI $(d_2) \perp (d)$ et $(d_2) \perp (d)$ → **ALORS** (d_1) et ..... sont .....

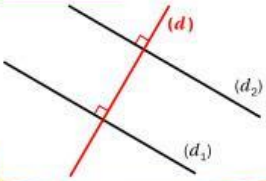

SI $(d_1) // (d_2)$ et $(d_1) \perp (d)$ → **ALORS** (d) est ..... à .....

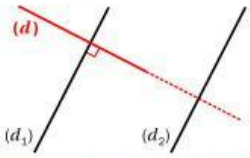

Position relative de deux droites

Droites.....

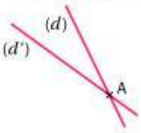

A est le point d'.....

Droites .....

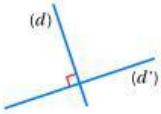

Notation : ..... ⊥ .....

Droites.....

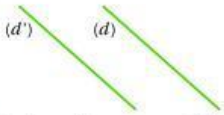

Notation : (d) ..... (d').

LIVEWORKSHEETS