Benchmark Fractions

MATH MONKS

Use the benchmark fractions and shade the shape. Then compare the 2 fractions for each question and put '>' or '<' sign in the circle.

Example:

$\frac{1}{2}$

$\frac{1}{4}$ 

$\frac{1}{2}$ > $\frac{1}{4}$

1. $\frac{3}{8}$ 

   $\frac{5}{16}$ 

   $\frac{3}{8}$ ◯ $\frac{5}{16}$

2. $\frac{6}{7}$ 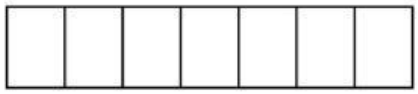

   $\frac{8}{14}$ 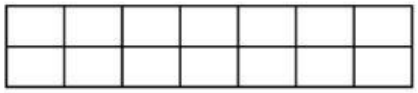

   $\frac{6}{7}$ ◯ $\frac{8}{14}$

3. $\frac{5}{6}$ 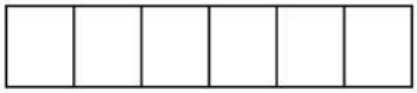

   $\frac{2}{8}$ 

   $\frac{5}{6}$ ◯ $\frac{2}{8}$

4. $\frac{2}{3}$

   $\frac{1}{5}$

   $\frac{2}{3}$ ◯ $\frac{1}{3}$

5. $\frac{6}{10}$ 

   $\frac{3}{5}$

   $\frac{6}{10}$ ◯ $\frac{3}{5}$

6. $\frac{2}{12}$ 

   $\frac{1}{6}$

   $\frac{2}{12}$ ◯ $\frac{1}{6}$

7. $\frac{1}{3}$ 

   $\frac{4}{9}$ 

   $\frac{1}{3}$ ◯ $\frac{4}{9}$

LIVEWORKSHEETS