Intervalos abiertos y cerrados

CEB 5/2
CENTRO DE ESTUDIOS DE BACHILLERATO

Une la desigualdad con la recta que indica el intervalo

$-6 < x \leq 3$

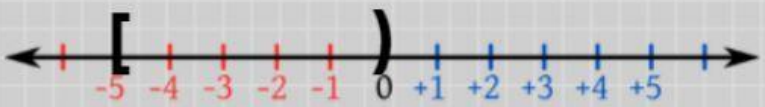

$-4 \leq x < 3$

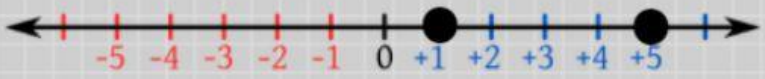

$-5 \leq x < 0$

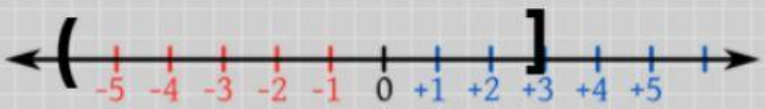

$1 \leq x \leq 5$

LIVEWORKSHEETS