DOMINÓ

Coloca el valor correspondiente.

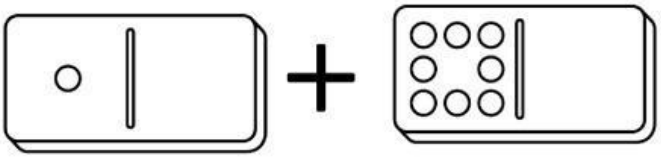

+ = _____

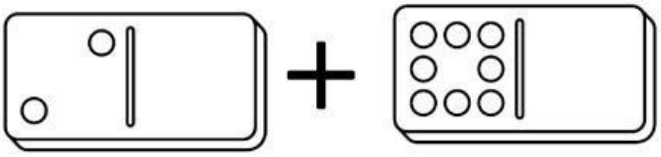

+ = _____

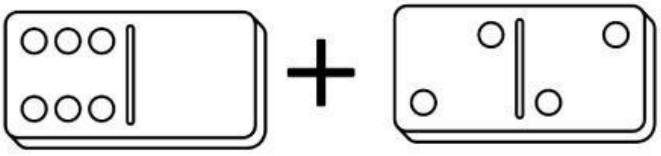

+ = _____

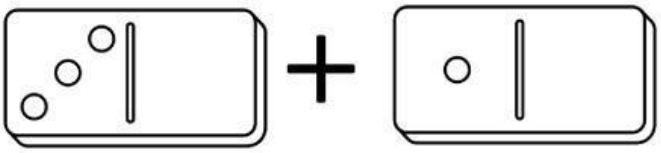

+ = _____

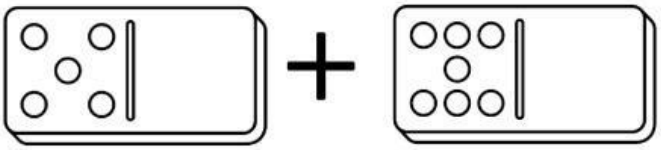

+ = _____

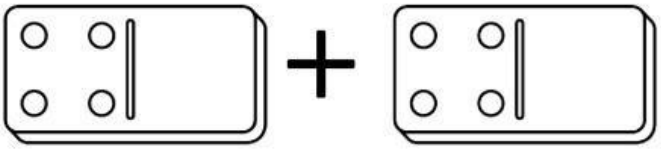

+ = _____

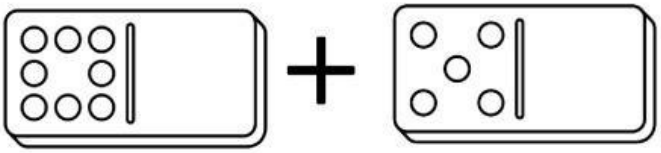

+ = _____

LIVEWORKSHEETS



FIGURAS GEOMETRICAS

Arrastra la figura con la opción correcta.



- rectangle



- hexagon

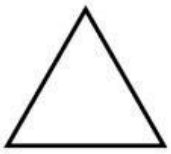

- pentagon

- circle

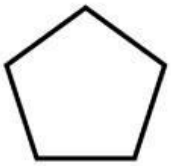

- triangle

- oval

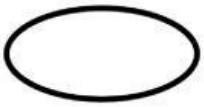

- octagon

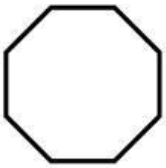

- square

LIVEWORKSHEETS

Antes y después

Escribí los números que están antes y después del número en el medio.

8	9	10
	6	
	3	
	5	
	12	
	18	

	7	
	11	
	3	
	5	
	4	
	2	

LIVEWORKSHEETS