مدارس ابن رشد
IBNROSHD SCHOOLS
AlNamothajiyah | النموذجية

Student name:	Subject: Math	Topic1: Fluently Add and Subtract within 20.
Grade : 2 /	Quiz 1	Date: ....__/9/2023

Assessment Practice Which shows how to count on to find 7 + 5?

Ⓐ 7. . . 8, 9, 10, 11, 12

Ⓑ 1, 2, 3, 4, 5

Ⓒ 7 – 5

Ⓓ 7. . . 8, 9, 10, 11

Count on to find the sum. Then change the order of the addends. Use cubes if needed.

9 + 3 = ____

____ + ____ = ____

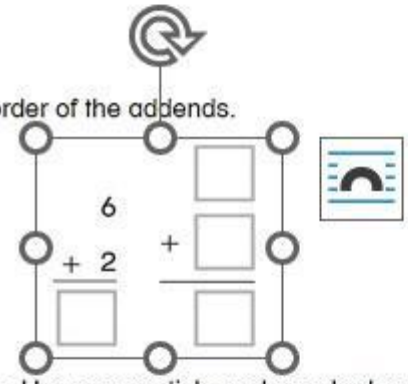

Ellie has 5 star stickers and 8 heart stickers. How many stickers does she have in all? Choose all the equations that match the story.

☐ 5 + 6 = 11

☐ 5 + 8 = 13

☐ 7 + 5 = 12

☐ 8 + 5 = 13

Complete each doubles fact. Solve each near doubles fact.

8 + 8 = ____ 8 + 9 = ____ | 5 + 5 = ____ 5 + 7 = ____

© by Savvas Learning Company LLC. All Rights Reserved

LIVEWORKSHEETS

Assessment Practice Kate wants to find 6 + 7.

Which doubles fact will help her the most?

Ⓐ 4 + 4 = 8
Ⓑ 6 + 6 = 12
Ⓒ 8 + 8 = 16
Ⓓ 9 + 9 = 18

Model John drew 4 houses. Then he drew 5 more houses. How many houses did John draw in all?

Draw a picture and write an equation to explain your thinking.

____ ◯ ____ = ____ houses

Assessment Practice Use the ten-frames. Show how to find 5 + 7 by making a 10. Then fill in the gray boxes.

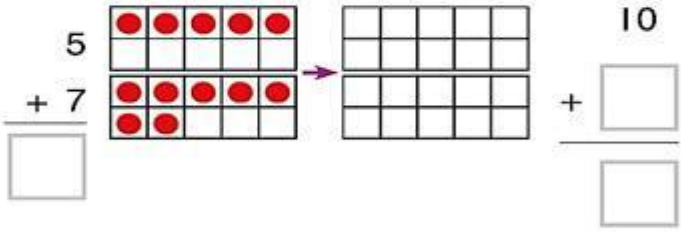

© by Savvas Learning Company LLC. All Rights Reserved

LIVEWORKSHEETS

Find the sum

$7 + 9 =$ _____



Use fact patterns to complete each equation.

+	0	1	2	3	4	5	6	7	8	9	10
0	0	1	2	3	4	5	6	7	8	9	10
1	1	2	3	4	5	6	7	8	9	10	11
2	2	3	4	5	6	7	8	9	10	11	12
3	3	4	5	6	7	8	9	10	11	12	13
4	4	5	6	7	8	9	10	11	12	13	14
5	5	6	7	8	9	10	11	12	13	14	15
6	6	7	8	9	10	11	12	13	14	15	16
7	7	8	9	10	11	12	13	14	15	16	17
8	8	9	10	11	12	13	14	15	16	17	18
9	9	10	11	12	13	14	15	16	17	18	19
10	10	11	12	13	14	15	16	17	18	19	20

Enter the missing numbers in the boxes.

10 + [ ] = 16

[ ] + 7 = 16

8 + [ ] = 16

[ ] + 9 = 16

© by Savvas Learning Company LLC. All Rights Reserved

LIVEWORKSHEETS