A chef arranges 4 rows of 3 red peppers on a tray. He adds 2 more rows of 3 yellow peppers. How many peppers are there altogether?

Read **Draw** **Write**

© Great Minds PBC TEKS Edition | greatminds.org/Texas

LIVEWORKSHEETS

LIVEWORKSHEETS

Name _____ Date _____

1. There are 8 birds at the pet store. Two birds are in each cage. Circle to show how many cages there are.



8 ÷ 2 = _____

There are _____ cages of birds.

---

2. The pet store sells 10 fish. They equally divide the fish into 5 bowls. Draw fish to find the number in each bowl.

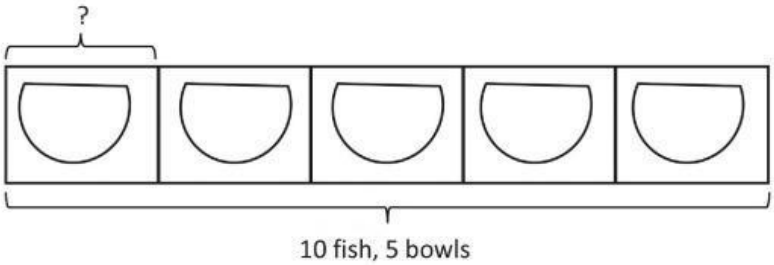

5 × _____ = 10

10 ÷ 5 = _____

There are _____ fish in each bowl.

---

3. Match.

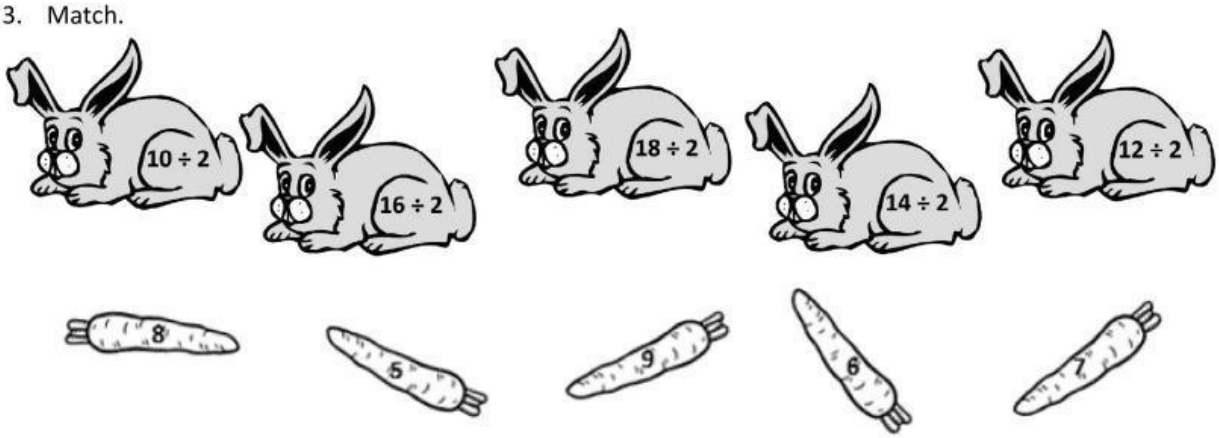

© Great Minds PBC TEKS Edition | greatminds.org/Texas

LIVEWORKSHEETS

4. Laina buys 14 meters of ribbon. She cuts her ribbon into 2 equal pieces. How many meters long is each piece? Label the strip diagram to represent the problem, including the unknown.

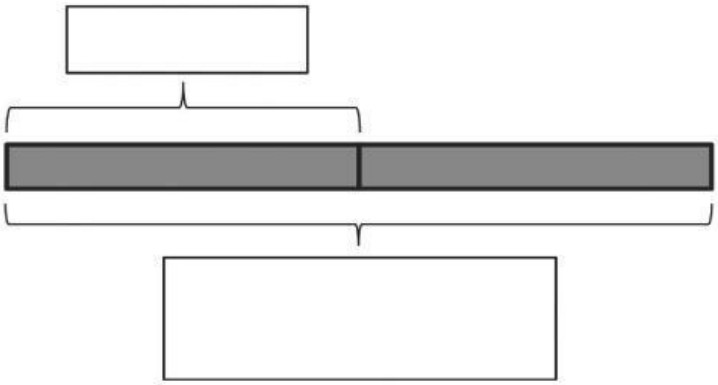

Each piece is _____ meters long.

5. Roy eats 2 cereal bars every morning. Each box has a total of 12 bars. How many days will it take Roy to finish 1 box?

6. Sarah and Emma equally share the cost of a present. The present costs $18. How much does Sarah pay?

© Great Minds PBC TEKS Edition | greatminds.org/Texas

EUREKA MATH TEKS EDITION

LIVEWORKSHEETS

Name _____ Date _____

There are 14 mints in 1 box. Cecilia eats 2 mints each day. How many days does it take Cecilia to eat 1 box of mints? Draw and label a strip diagram to solve.

It takes Cecilia _____ days to eat 1 box of mints.

© Great Minds PBC TEKS Edition | greatminds.org/Texas

LIVEWORKSHEETS

LIVEWORKSHEETS