СВОЙСТВО ТОЧЕК БИССЕКТРИСЫ УГЛА. СВОЙСТВО КАТЕТА ПРЯМОУГОЛЬНОГО ТРЕУГОЛЬНИКА, ЛЕЖАЩЕГО ПРОТИВ УГЛА В 30°

ВАРИАНТ 2

I УРОВЕНЬ

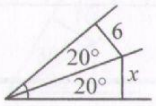

1. $x = ?$

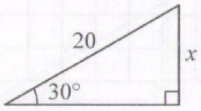

2. $x = ?$

II УРОВЕНЬ

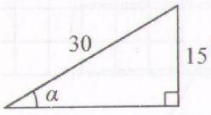

3. $\alpha = ?$

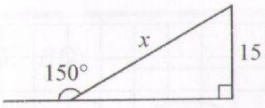

4. $x = ?$

III УРОВЕНЬ

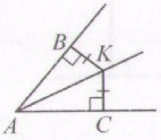

6. $\angle A = 50°$. $\angle AKB = ?$

IV УРОВЕНЬ

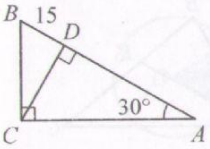

7. $AD = ?$

V УРОВЕНЬ

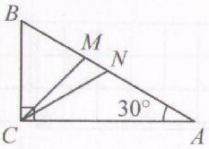

9. $\angle C = 90°$, $CN = NB$, $\angle ACM = \angle MCB$. $\angle MCN$?

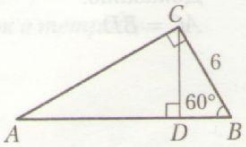

10. *Дано*: $\angle ACB = 90°$, $\angle B = 60°$, $BC = 6$ см.
Найти: AD.

LIVEWORKSHEETS