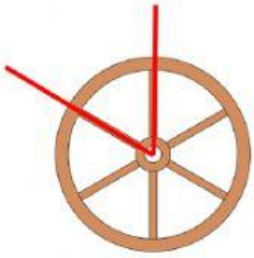

This wheel has 6 evenly spaced spokes.

a) How big is the angle shown in red? degrees

b) Another wheel has an angle of 30° between each spoke. How many spokes does it have?

a) The dress is reduced by 20%. What is the new price? $

b) The shorts have a one third off sale. What is the new price? $

c) The shoes are 30% off. How much are you saving? $

A table at a restaurant can seat 4 people. 2 tables can seat 6 people.
This is shown in the table below. Fill in the rest.

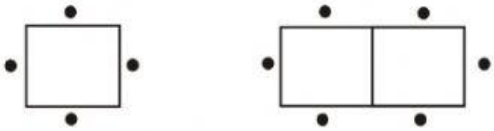

Number of tables	Number of people sitting
1	4
2	6
3	
4	
10	

LIVEWORKSHEETS

In class 4C there are twice as many girls as there are boys.

There are 18 girls

a) How many boys are there?

b) How many students are in the class altogether?

a) How many vertices does this shape have?

b) How many vertices does a sphere have?

c) How many vertices does a square based pyramid have?

Lucy wants to buy some pencils from a shop.
Each pencil costs 35 cents

a) How many pencils can Lucy buy?

b) How much money will she have left?



LIVEWORKSHEETS