LEMBAR KEGIATAN PESERTA DIDIK

MATEMATIKAA

DIM3NSI

Pungkas Yonandher S.,S.Pd

PETUNJUK :

1. BACA SOAL ISILAH /PILIH JAWABAN PADA TITIK DENGAN TEPAT
2. JAWABAN MENGGUNAKAN **HURUF KAPITAL**
3. KLIK 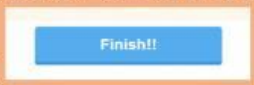

4. KLIK
5. ENTER YOUR FULL NAME diisi **NAMA LENGKAP** (HURUF KAPITAL)
6. GROUP/LEVEL diisi KELAS misalnya : XII IPS 1(HURUF KAPITAL)
7. SCHOOL SUBJECT diisi "**MATEMATIKA** "
8. Lalu klik " **SEND** "

LIVEWORKSHEETS

1. PILIHLAH JAWABAN TEPAT DIBAWAH INI !
   PERHATIKAN GAMBAR!

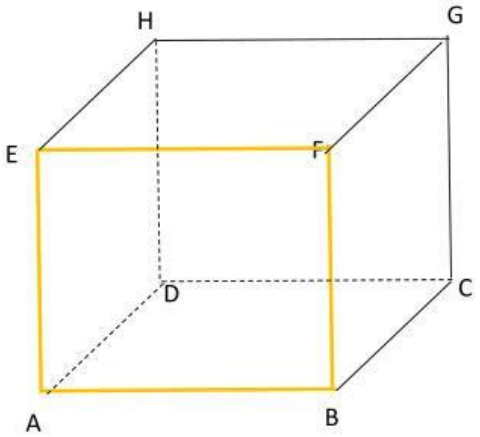

LIVEWORKSHEETS

▪ Titik diluar garis EF	. . .	• EC
▪ Garis yang sejajar dengan garis CG	. . .	• A
▪ Bidang bidang diagonal ruang	. . .	• AE
▪ Garis diagonal bidang	. . .	• BCEH
▪ Garis diagonal ruang	. . .	• DG

2. Diketahui Kubus PQRS.TUVW

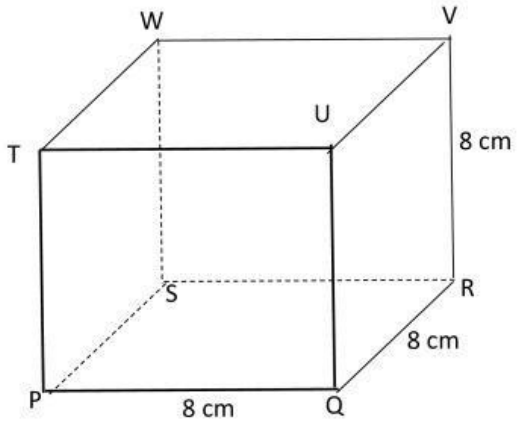

▪ Jarak Titik T ke titik U	= . . . cm

LIVEWORKSHEETS

- Jarak Titik Q ke titik S

$$QS^2 = PQ^2 + PS^2$$

$$QS = \sqrt{(PQ)^2 + (PS)^2}$$

$$QS = \sqrt{(\ldots)^2 + (\ldots)^2}$$

$$QS = \sqrt{\ldots + \ldots}$$

$$QS = \sqrt{\ldots}$$

$$QS = \sqrt{\ldots x \ldots}$$

$$QS = \ldots\sqrt{\ldots}\ cm$$

- Jarak Titik Q ke titik W

$$QW^2 = QS^2 + WS^2$$

$$QW = \sqrt{(QS)^2 + (WS)^2}$$

$$QW = \sqrt{(\ldots\sqrt{\ldots})^2 + (\ldots)^2}$$

$$QW = \sqrt{\ldots x \ldots + \ldots}$$

LIVEWORKSHEETS

$QW = \sqrt{\ .\ .\ .}$

$QW = \sqrt{\ .\ .\ .x\ .\ .\ .}$

$QW = .\ .\ .\sqrt{\ .\ .\ .}\ \ cm$

SELAMAT MENGERJAKAN

LIVEWORKSHEETS