Area and Perimeter

1) Calculate the Area and Perimeter



Area m^2

Perimeter m

2) Calculate Area and Perimeter

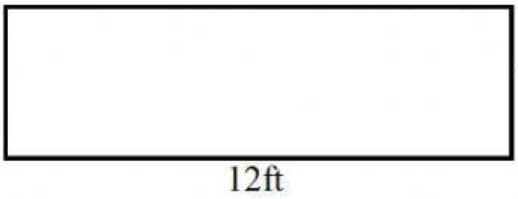

Area ft^2

Perimeter ft

3) Calculate the Area

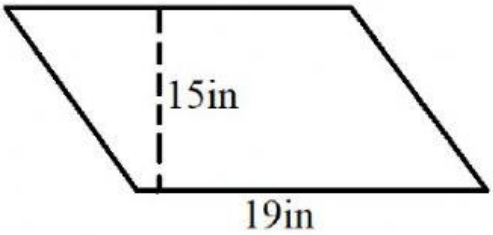

Area in^2

4) Calculate the missing angle

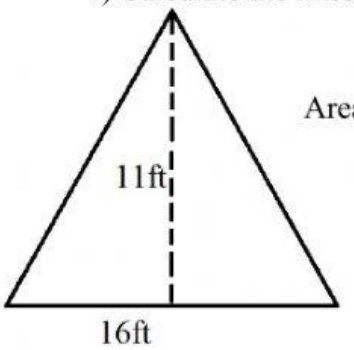

Area ft^2

5) Calculate the missing angle

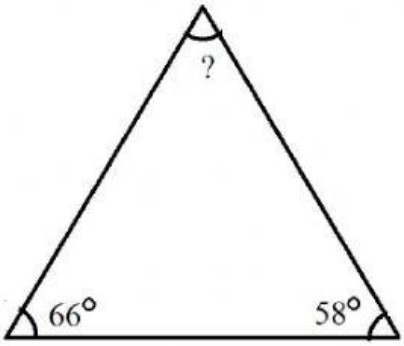

6) Calculate the Area

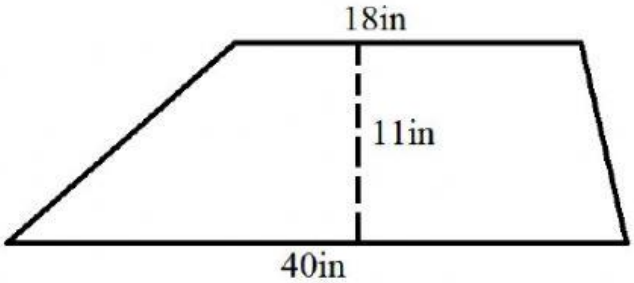

Area in^2

7) What is the area of a square whose side is equal to 7 yds? yd^2

8) What is the perimeter of a rectangle with a length of 10.2 m and length of 12.8m? m

9) What is the area of a parallelogram with a height of 13in and base of 16in? in^2

10) What is the area of a triangle with a base of 18 ft and height of 13 ft? ft^2

LIVEWORKSHEETS