2ND GRADE – MATHS
NUMBERS UP TO 1000

INTERACTIVE WORKSHEET 05

I. Write the missing numbers from 501 to 1000.

501									510
				535					
551									560
				575					
591									600

II. Write the numbers corresponding to the given representations.

1.
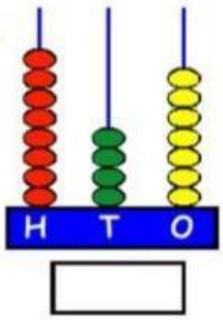

2.
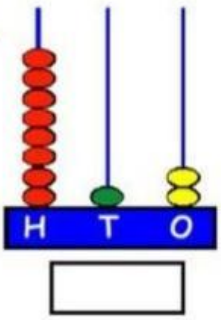

3.
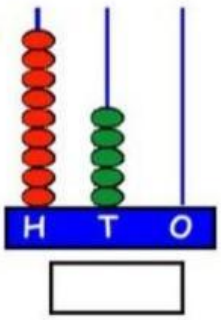

4.
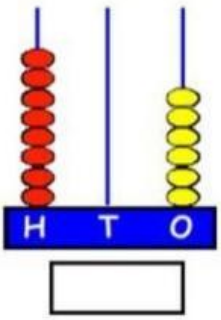

GALAXY ESCHOOL
LIVEWORKSHEETS