Ms. Marwa Abu Najm

Model and describe tenths



$\frac{\square}{10} = \square$

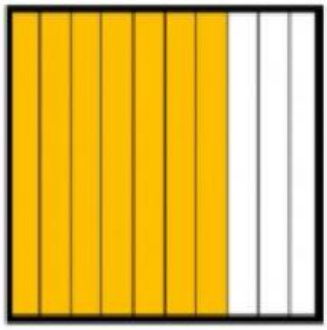

$\frac{\square}{10} = \square$



$\frac{\square}{10} = \square$

Convert between these fractions and decimals

$\frac{4}{10} = \square$

$\frac{\square}{10} = 0.8$

LIVEWORKSHEETS