Ms. Marwa Abu Najm

Model and describe tenths



$\frac{\square}{10} = \square$

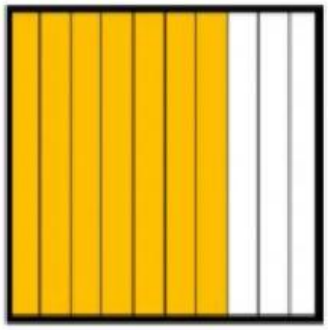

$\frac{\square}{10} = \square$



$\frac{\square}{10} = \square$

LIVEWORKSHEETS