ROLL NO: | NAME: | SECTION:

WORKSHEET# 6

PICTOGRAPH AND 2D-SHAPES

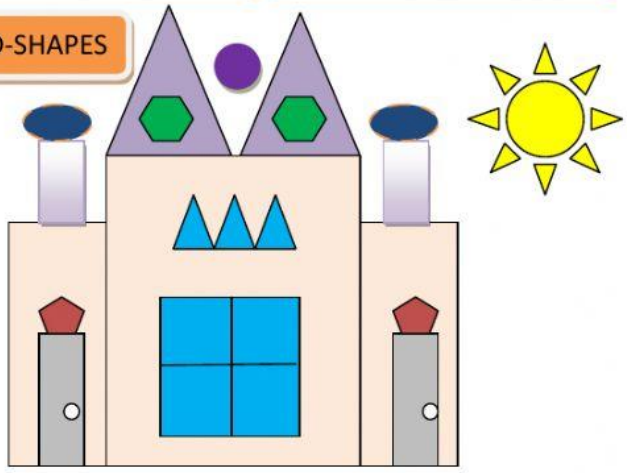

Q1. Count and write.

Square: _____

Rectangle: _____

Triangle: _____

Oval: _____

Circle: _____

Pentagon: _____

Hexagon: _____

Q2. Complete the table.

Shapes	Names	Number of corners	Number of sides

Q3. Look at the pattern and drag the shape that comes next.

a)  _____

b) 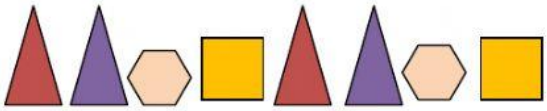 _____ 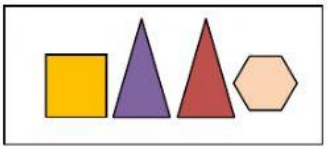

Q4. Look at the pictograph and answer the following questions.

1. **How many apple trees are there in the garden?** _____

2. **How many peach trees are there in the garden?** _____

3. **How many guava trees are there in the garden?** _____

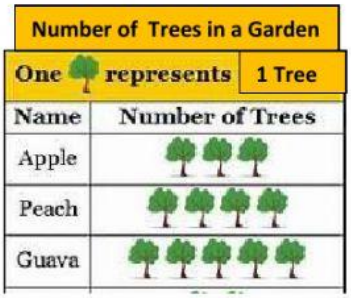

Number of Trees in a Garden	
One 🌳 represents	1 Tree
Name	Number of Trees
Apple	🌳🌳🌳
Peach	🌳🌳🌳🌳
Guava	🌳🌳🌳🌳🌳

LIVEWORKSHEETS