	ELABORACIÓN DE MATERIAL ACADÉMICO CONTROLADO FECHA: 10/02/2020	Código: 2.2-FT-EMA	
		Versión 1	Vigencia: NOV. 2018
		Revisado: FEB 2020	
		Página **1** de **2**	

Nombre: área: Matemáticas GRADO: 3 PROFESOR: Lady Correa

Escribir la fracción correspondiente y unir las fracciones que sean equivalentes.

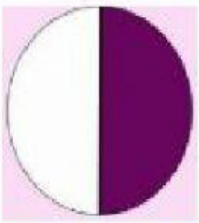

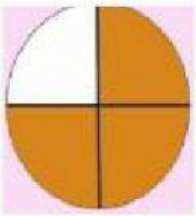

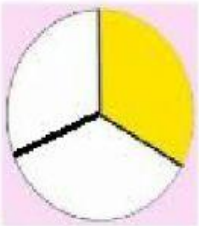

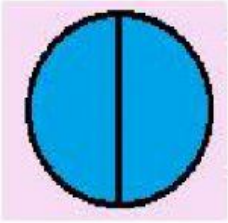

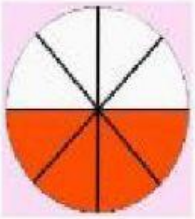

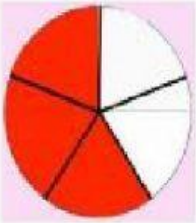

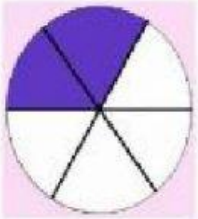

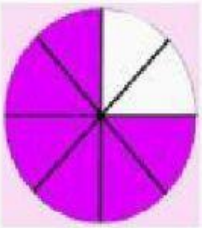

LIVEWORKSHEETS

2. amplificar las fracciones por 5

$$\frac{6}{4} \rightarrow \frac{\square}{\square} = \frac{\square}{\square}$$

$$\frac{2}{3} \rightarrow \frac{\square}{\square} = \frac{\square}{\square}$$

3. simplificar por 2

$$\frac{16}{64} \rightarrow \frac{\square}{\square} = \frac{\square}{\square}$$

$$\frac{20}{36} \rightarrow \frac{\square}{\square} = \frac{\square}{\square}$$

4. Probar si son equivalentes y colocar si o no

$\frac{2}{8}$ y $\frac{5}{10}$ prueba 2 * __ y 8 * ___ ☐

$\frac{2}{8}$ y $\frac{16}{64}$ prueba 2 * __ y 8 * ___ ☐

LIVEWORKSHEETS