LKPD

NAMA : Muhammad Areski

NIM: 20800121051

Soal

1. Yang manakah gambar dari gerhana bulan total

   a.

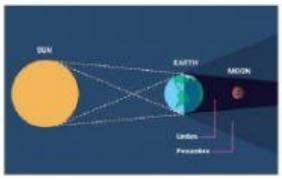

   b.

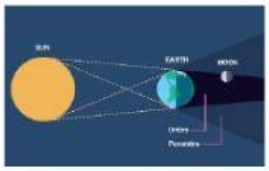

   c.

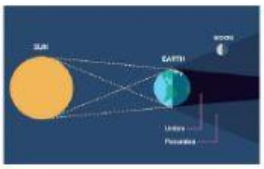

2. Yang manakah gambar dari gerhana bulan sebagian

LIVEWORKSHEETS

a.

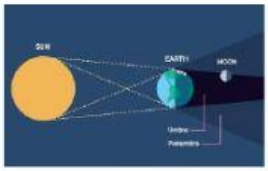

b.

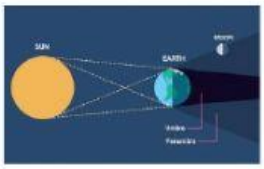

c.

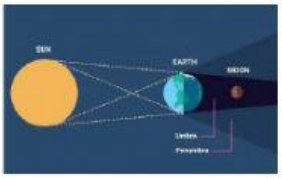

3. Yang manakah gambar dari gerhana bulan penumbra

a.

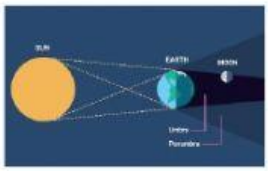

LIVEWORKSHEETS

b.

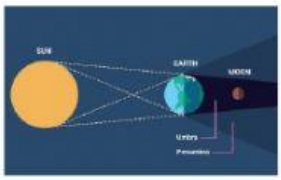

c.

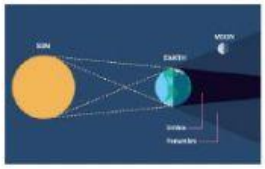

4. Perputaran bulan pada porosnya disebut

   a. Rotasi bumi
   b. Rotasi bulan
   c. Revolusi bulan

5. Bayangan inti yang berada di bagian tengah sangat gelap, pada saat terjadi gerhana disebut...

   a. gerhana
   b. orbit
   c. umbra

LIVEWORKSHEETS

LIVEWORKSHEETS