Match each function with its graph.

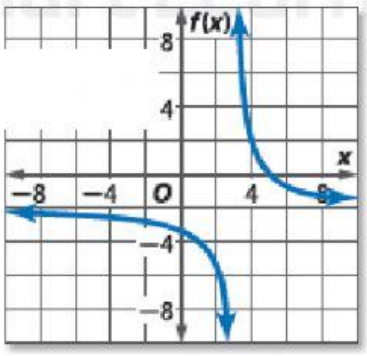

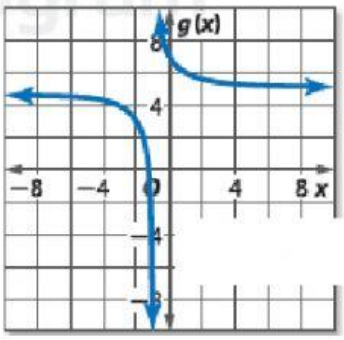

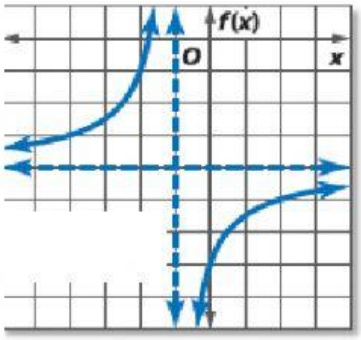

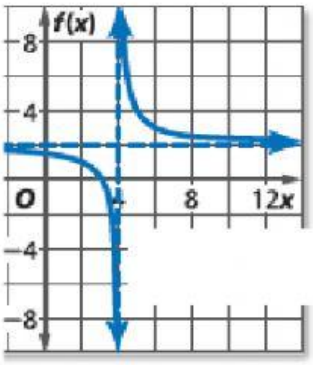

$f(x) = \frac{2}{x-4} + 2$ $f(x) = \frac{-3}{x+1} - 4$ $g(x) = \frac{2}{x+1} + 5$ $f(x) = \frac{4}{x-3} - 2$

LIVEWORKSHEETS