សាលារៀនគ្រូយើង
យើងសម្លឹងទៅរកអនាគតដ៏ភ្លឺស្វាង!
យើងកសាងកូនល្អជូនលោកអ្នកនិងសង្គមជាតិ!

KROU YEUNG SCHOOL
We are looking forward to a Brilliant Future!
We build the best generation for you and the nation!

Student's name: _____ Teacher's name: _____
Gender: _____ Date: _____ / _____ / _____
Class: _____ / Grade: 1

Quarter IV
Math quiz I

I. Choose word to complete.

Third	First	Second	Fourth	Fifth	Sixth	Seventh	Eighth	Tenth	Ninth

1st First 6th _____
2nd _____ 7th _____
3rd _____ 8th _____
4th _____ 9th _____
5th _____ 10th _____

Left Right

Ex: The star is Fifth from the right.
1.The star is _____ from the Left.
2.The circle is _____ from the right.
3.The triangle is _____ from the left.
4.The rectangle is _____ from the left.

II. Write — or +

a. 10 ☐ 6 = 4
b. 16 ☐ 9 = 7
c. 11 ☐ 3 = 14
d. 17 ☐ 2 = 15
e. 7 ☐ 5 =12
f. 9 ☐ 7= 16
g. 14 ☐ 6 =20

III. Fill in the blank

a.13 = 1 ten 3 ones.
b.17 = _____ten 7 ones.
c.14 = 1 ten _____ ones.
d.16 = _____ten 6 ones.
e.18 = 1 ten _____ones.
f.15 = 1 ten _____ ones.
g.19 = 1 ten _____ones.

LIVEWORKSHEETS

V. Write the number pattern.

A.



B.



C.

8	9	10		12	13		15

D.

12	13		15	16		18	

E.

10		12	13		15	16	

VI Comparing two object.

+ Write taller / shorter.



1. The giraffe is _____ than the tree.
2. The tree is _____ than giraffe.
3. The cat is _____than tree.
4. The tree is _____than cat.
5. Giraffe is _____ than cat.

+ Write Longer/ shorter.



1. The ruler is _____ than pencil.
2. The eraser is _____ than pencil.
3. The pencil is _____ than eraser.
4. The crayon is _____ than ruler.
5. The ruler is _____ than crayon.

Vii word problem: Hanna has 5 apples .Jully gives her 5 more apple .

How many apples does Hanna have altogether?

Hanna has _____apples altogether.

LIVEWORKSHEETS