Cluster 5 Task 3

Part 1

a) Di el número 52

Representa el número

52



b) Di el número 65

Representa el número

65



LIVEWORKSHEETS

Part 2

a) **¿Cuántos cubos hay?**



Escribe el número: _____

Di el número: _____

a) **¿Cuántos cubos hay?**



Escribe el número: _____

Di el número: _____

LIVEWORKSHEETS