Nome: Data:

1. Preenche os espaços completando os números de 2 em 2, por ordem crescente.

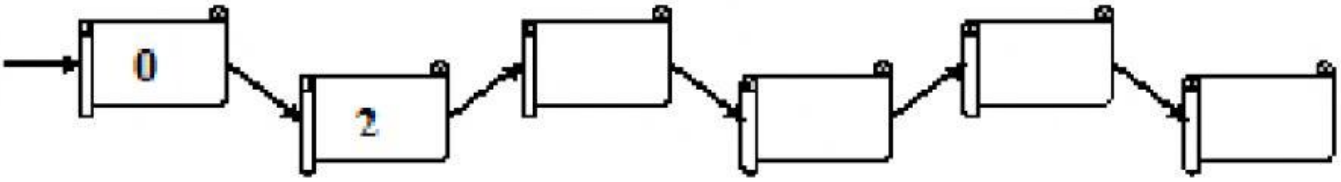

2. Decompõe os números

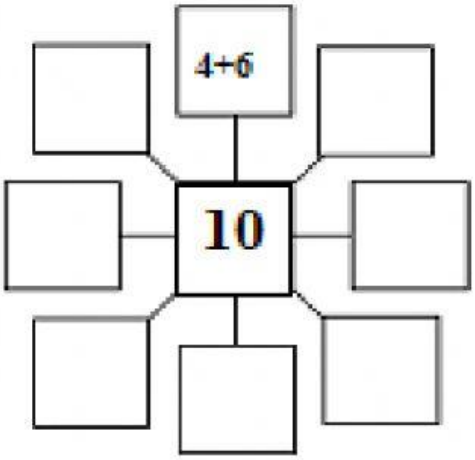

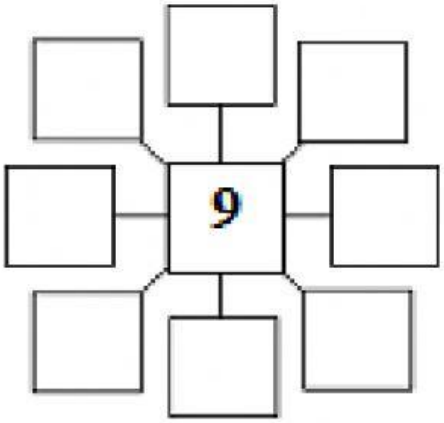

3. Ordena os seguintes números por ordem decrescente.

3 5 4 9 2 1 8 10

_____

4. Completa.

____unidades



____unidades

____unidades

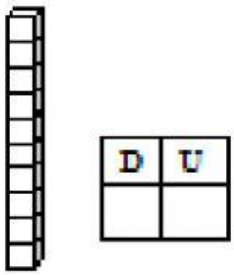

____dezena e
____unidades

LIVEWORKSHEETS

- Faz como no exemplo. Escreve o nome dos números.

1 – um - 1 unidade

2 - _____

3 - _____

4 - _____

5 - _____

6 - _____

7 - _____

8 - _____

9 - _____

10 - _____

– Completa:

8 + 2 = _____	9 + 1 = _____	10 – 6 = _____	10 – 10 = _____
7 + 3 = _____	4 + 6 = _____	10 – 9 = _____	10 – 0 = _____
6 + 4 = _____	3 + 7 = _____	10 – 1 = _____	10 + 0 = _____
5 + 5 = _____	2 + 8 = _____	10 – 4 = _____	10 – 5 = _____

– Completa:

1 ____ - ____ - ____ - ____ - ____ - ____ - ____ - ____ 10

10 - ____ - ____ - ____ - ____ - ____ - ____ - ____ - ____ 1

– Completa:

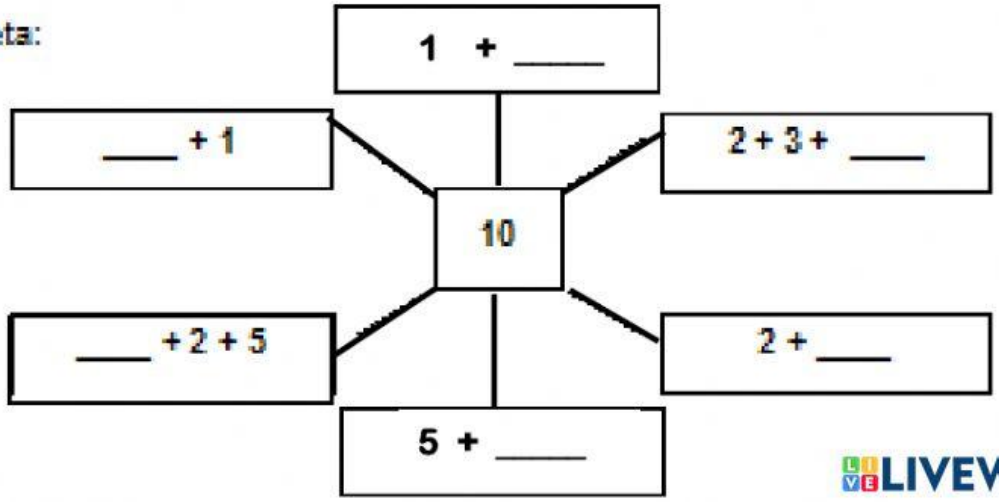

LIVEWORKSHEETS