Cambridge Assessment International Education
Cambridge International School

Cambridge Primary Programme

CAMBRIDGE PRIMARY MATHEMATICS 1

UNIT 36-37. OBSERVING TIME

Name: _____ **Date:** _____ **Class:** _____

Let's learn

TELLING THE TIME

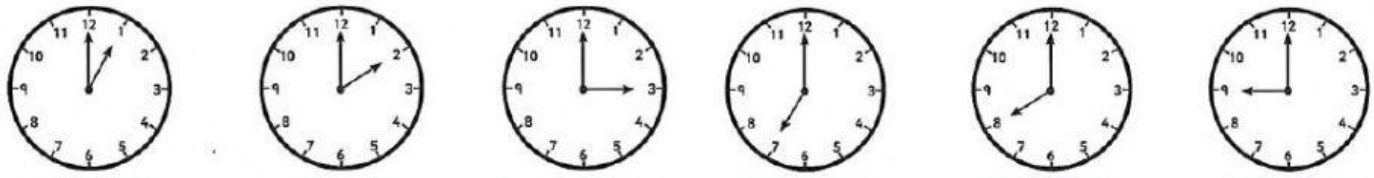

one o'clock | two o'clock | three o'clock | seven o'clock | eight o'clock | nine o'clock



four o'clock | five o'clock | six o'clock | ten o'clock | 11 o'clock | 12 o'clock

Half past ten

Half past eleven

DAYS OF A WEEK

MONTHS OF THE YEAR

LIVEWORKSHEETS

Let's practice

1. Write the time under each clock.

o'clock	half past

5 o'clock

2. Circle the correct time.

(a)

4 o'clock 5 o'clock 6 o'clock

7 o'clock 8 o'clock 9 o'clock

1 o'clock 2 o'clock 3 o'clock

LIVEWORKSHEETS

(b)

It is 7 o'clock in the morning.

It is 10 o'clock in the morning.



It is 3 o'clock in the afternoon.



It is 5 o'clock in the afternoon.

3. Write these months of the year in the right order.

June _____

November _____

September _____

February _____

December _____

August _____

July _____

January _____

May _____

March _____

April _____

October _____

LIVEWORKSHEETS

4. Write the correct day in the blank.

Monday Tuesday Wednesday Thursday Friday Saturday Sunday

Sunday	Monday	

	Tuesday	Wednesday

Thursday		Saturday

	Friday	Saturday

5. Complete the table.



The day before	Today	The day after
	Thursday	
Sunday		
		Sunday
	Tuesday	

LIVEWORKSHEETS