A. Fill in the blanks with the following words.

Cylinder	Sphere	Cube	Square
Triangle	Circle	Cuboid	



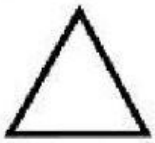

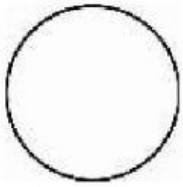

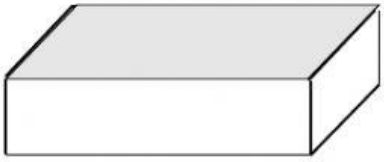

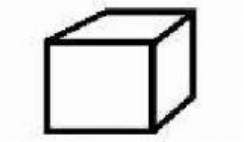

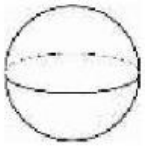

LIVEWORKSHEETS

B. What is the texture of these objects? Soft, hard, rough, or smooth?

C. What are they made of? Wood, metal, glass, plastic, or rubber?

D. Group these objects based on their similar properties.

LIVEWORKSHEETS



E. Fill in the blanks.

1. During the daytime we can see the ..... and clouds.
2. We cannot see the sun directly because it is too .....
3. We feel thirsty during the .....
4. Look at the picture.

When the sky has lots of clouds, it is a .....

5. The drops of water from clouds are called .....
6. we must wear ..... to prevent ourselves from falling sick.

LIVEWORKSHEETS

7. Look at the picture.

The ground becomes hot and dry. It happens on .....

8. Look at the picture.

Farmers plant ..... during the dry season.

9. The air is cool, and we cannot have outdoor activities.

These conditions happen on .....

10. The animals which like rain are .....

11. Look at the picture.

The wind is needed for .....

LIVEWORKSHEETS

12. Look at the picture.

These are ……

13. During spring, the weather becomes …….

14. The hottest season is …….

15. The coldest season is ……

LIVEWORKSHEETS