1. Troba el comú denominador i escriu les fraccions equivalents segons aquest.

$\frac{2}{3}$ i $\frac{4}{7}$

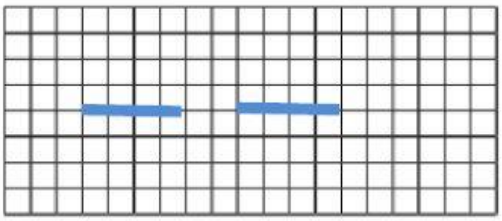

$\frac{3}{5}$ i $\frac{5}{7}$

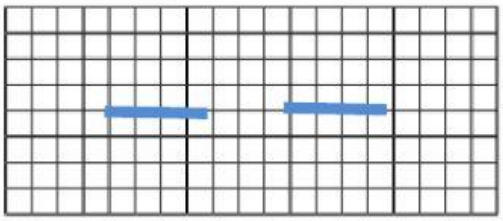

$\frac{5}{6}$ i $\frac{2}{9}$

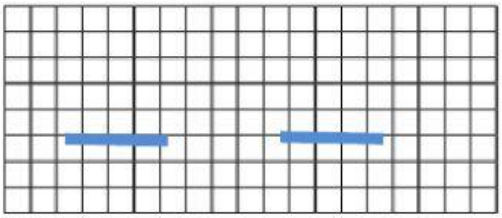

$\frac{4}{5}$ i $\frac{6}{10}$

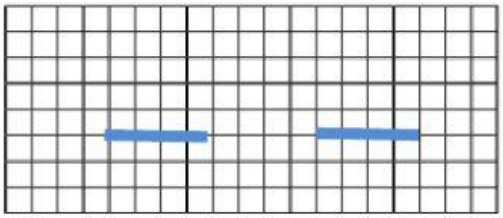

$\frac{4}{6}$ i $\frac{6}{8}$

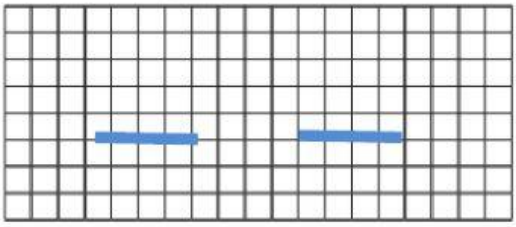

$\frac{9}{3}$ i $\frac{4}{15}$

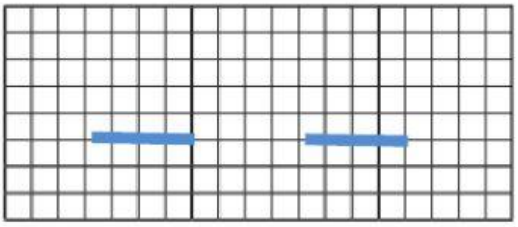

LIVEWORKSHEETS

$\frac{2}{4}$ i $\frac{3}{5}$

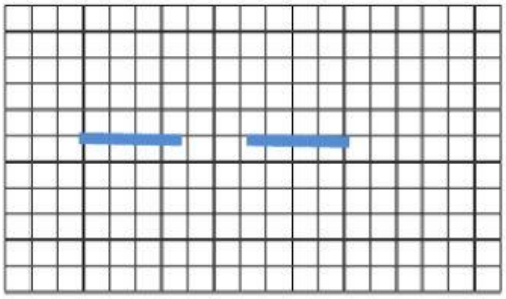

$\frac{3}{2}$ i $\frac{6}{8}$

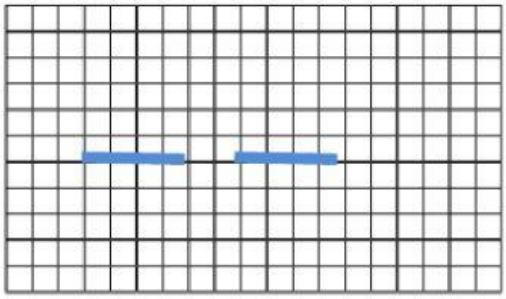

$\frac{2}{5}$, $\frac{1}{3}$ i $\frac{3}{2}$

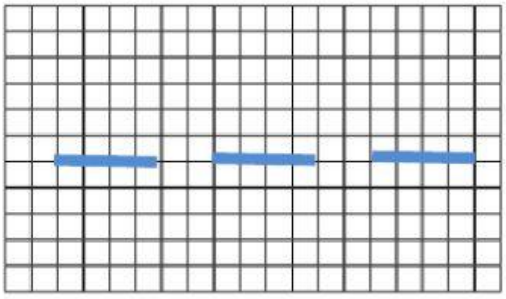

$\frac{1}{2}$, $\frac{3}{4}$ i $\frac{5}{6}$

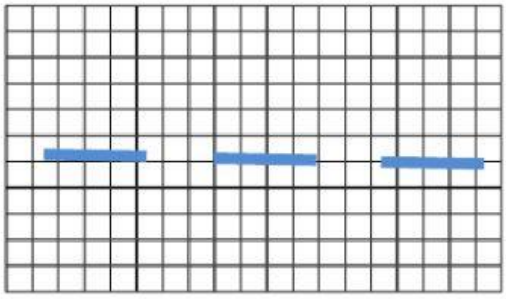

Ordena les fraccions següents de més gran a més petita:

- $\frac{3}{5}$, $\frac{9}{5}$ i $\frac{4}{5}$ ▶ ____ > ____ > ____
- $\frac{7}{9}$, $\frac{7}{3}$ i $\frac{7}{5}$ ▶ ____ > ____ > ____
- $\frac{5}{12}$, $\frac{11}{12}$ i $\frac{16}{12}$ ▶ ____ > ____ > ____
- $\frac{5}{3}$, $\frac{5}{8}$ i $\frac{5}{12}$ ▶ ____ > ____ > ____

3. Primer, redueix cada parella de fraccions a comú denominador i, després, compara-les: > <

- $\frac{3}{5}$ ◯ $\frac{4}{7}$ ▶ ____ ____
- $\frac{2}{3}$ ◯ $\frac{5}{9}$ ▶ ____ ____
- $\frac{11}{10}$ ◯ $\frac{5}{4}$ ▶ ____ ____

FT-42-GN-001

LIVEWORKSHEETS

. **Calcula les sumes següents:**

$$\frac{2}{3} + \frac{7}{12}$$

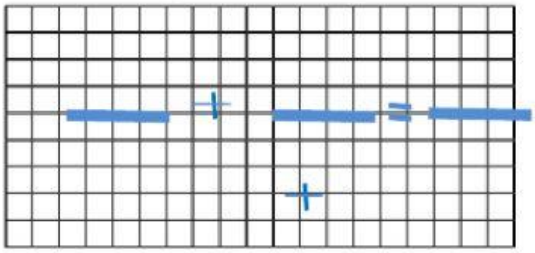

$$\frac{1}{4} + \frac{8}{4}$$

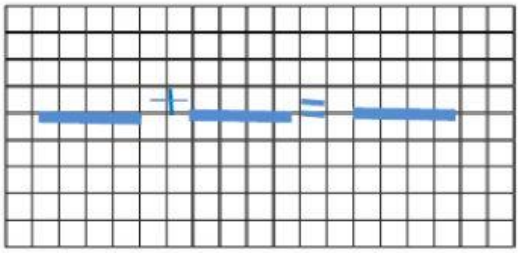

$$\frac{4}{5} + \frac{5}{6}$$

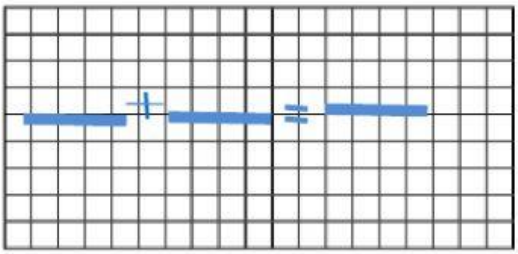

$$\frac{4}{7} + \frac{6}{7}$$

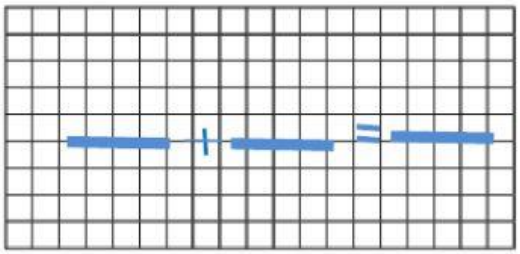

$$\frac{12}{16} + \frac{14}{16}$$

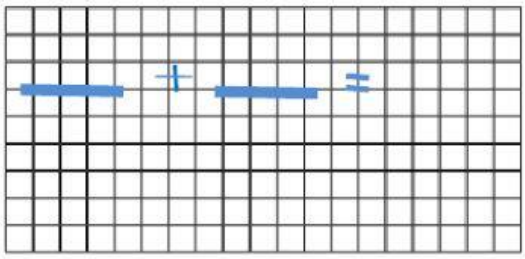

$$4 + \frac{1}{3}$$

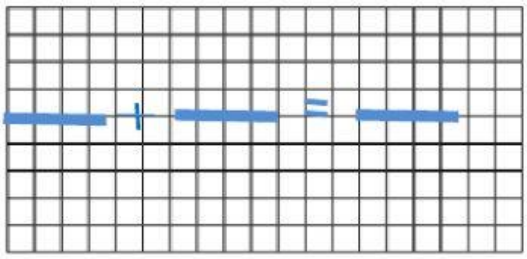

LIVEWORKSHEETS

. **Calcula les restes següents:**

$$\frac{17}{20} - \frac{14}{20}$$

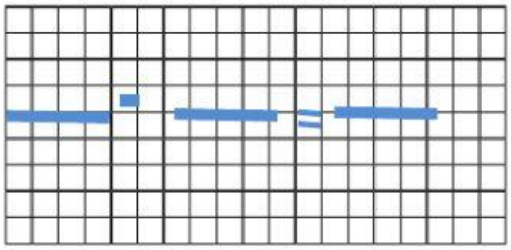

$$\frac{9}{12} - \frac{3}{8}$$

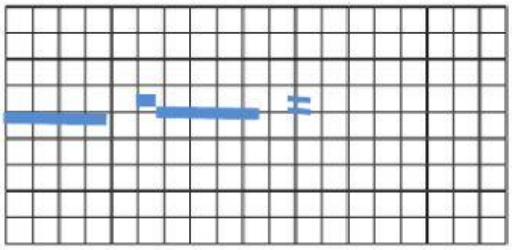

$$\frac{8}{6} - \frac{2}{4}$$

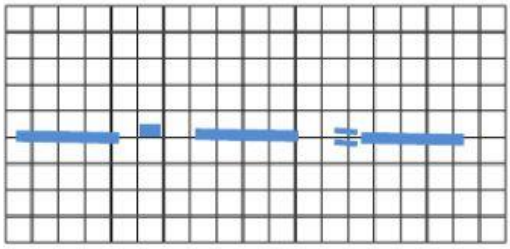

$$\frac{1}{9} - \frac{1}{12}$$

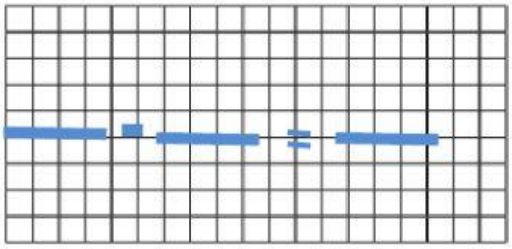

$$8 - \frac{3}{2}$$

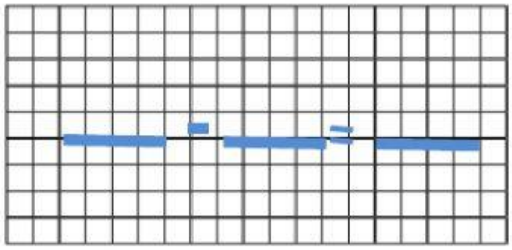

$$6 - \frac{2}{3}$$

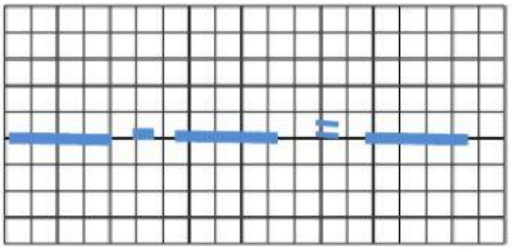

LIVEWORKSHEETS