Padankan imbangan dengan gambar di bawah. Kemudian, lakukan imbangan tersebut.

1.



2.

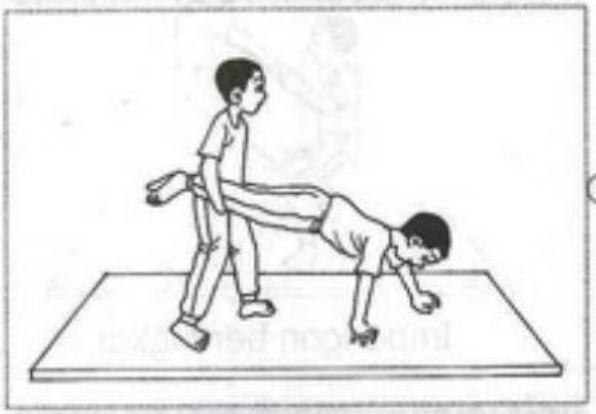

3.



4.

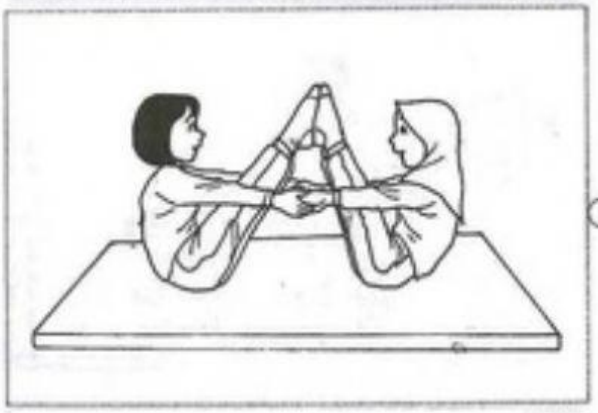

(a) Imbangan dekam

(b) Imbangan jambatan panjang

(c) Imbangan "V" berkembar

(d) Imbangan kereta sorong

LIVEWORKSHEETS