Makassed Dawha School
#Teach with Love

Name: _____ Grade "4"
Subject: Math Date: _____

Math LiveWorksheet

1- Read the figure and answer the questions:

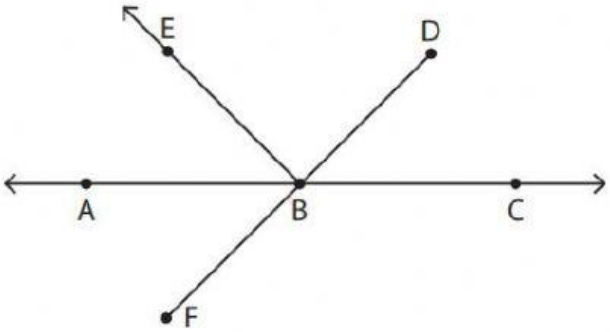

Name any three rays. _____

Name any two line segments. _____

Name the line in two ways. _____

2- Complete:

a.

The length of the segment is _____ cm and _____ mm.

The midpoint of this segment is at _____ cm and _____ mm.

LIVEWORKSHEETS

b.

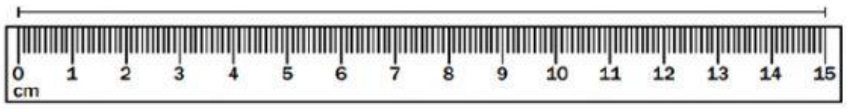

The length of the segment is _____ cm and _____ mm.

The midpoint of this segment is at _____ cm and _____ mm.

2- Answer the following questions:

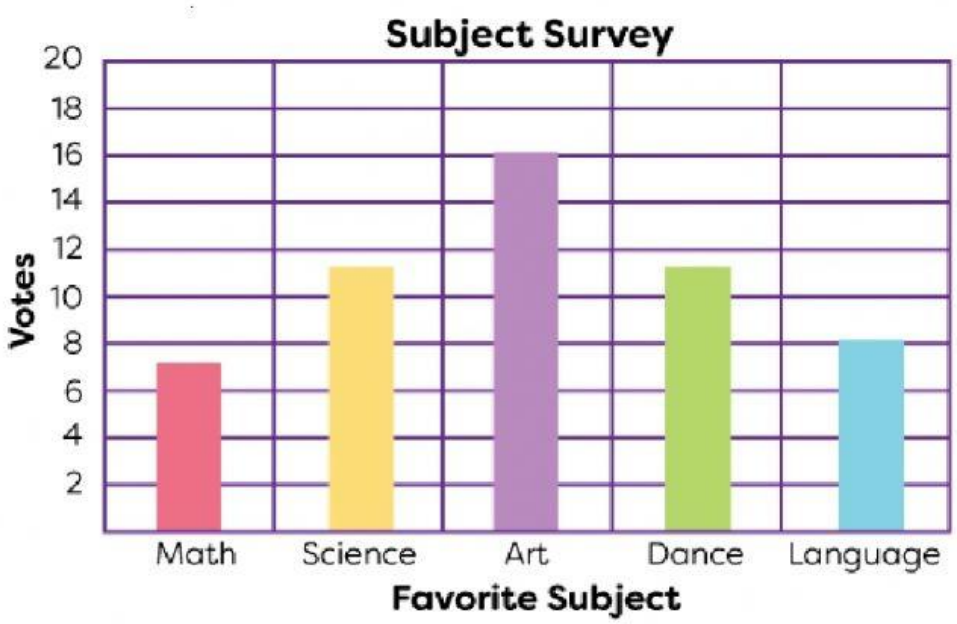

1. Which subject got the most votes?

_____

2. How many votes did Dance get?

_____

3. How many votes did Art get?

_____

4. How many more votes did Language get than Science?

_____

5. How many more votes did Math get than Art?

_____

LIVEWORKSHEETS