PLACE VALUE AND DIGIT VALUE

Activity 1

Write the numbers. Write the digits at the correct place value.

a



hundreds	tens	ones

b



hundreds	tens	ones

c



hundreds	tens	ones

d

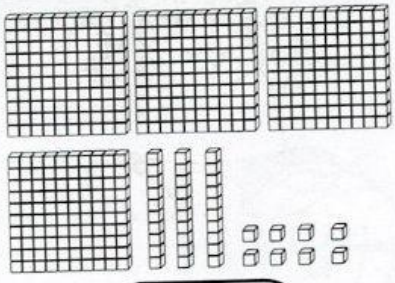

hundreds	tens	ones

e



hundreds	tens	ones

f



hundreds	tens	ones

Very good | Good | Try again

LIVEWORKSHEETS