Nama :

Kelas :

BAB 1

TEOREMA PYTHAGORAS

LATIHAN 4

Menentukan Jenis Segitiga dan Menentukan Panjang segitiga Siku-Siku Tanpa Tripel Pythagoras

A. Ketiklah huruf " **L** " jika ukuran segitiga adalah **segitiga Lancip**, " **T** " jika ukuran segitiga adalah **segitiga Tumpul** dan " **S** " jika ukuran segitiga adalah **segitiga siku-siku !** (*ketiklah dengan huruf besar !*)

1. 9, 11, 13 →

2. 6, 5, 8 →

3. 12, 16, 20 →

4. 7, 9, 11 →

5. 8, 12, 16 →

6. 10, 12, 16 →

B. Tentukanlah nilai dari p, q, r, s, t !

1. 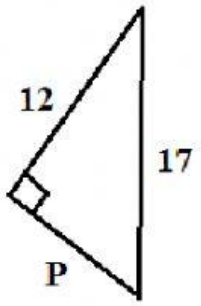

$p = \sqrt{}$

2. 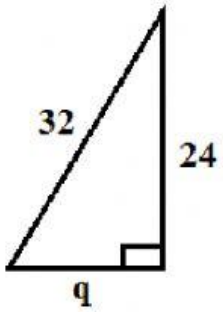

$q = \sqrt{\square}$

3. 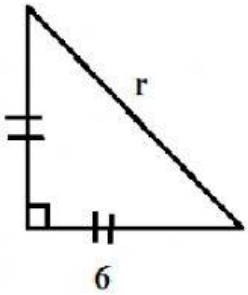

$r = \sqrt{\square}$

4. 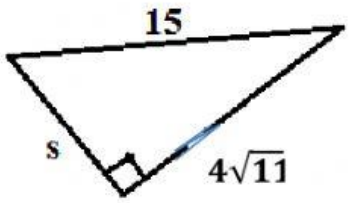

s =

5. 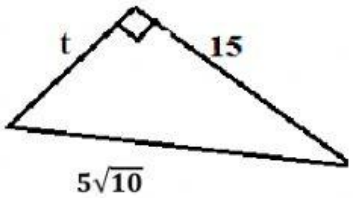

t =