NAME:_____ CLASS:_____

Marks

Activity 2

1 Look at the diagram. Write digit in its place value.

a



thousands	hundreds	tens	ones

b

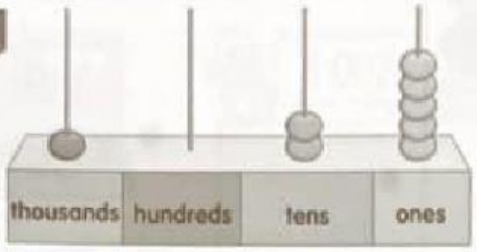

thousands	hundreds	tens	ones

c

thousands	hundreds	tens	ones

2 Write the place value for each underlined digit.

a

b

c

d

3 Write the digit value for each digit in these numbers.

a

b

Activity 3

Marks

1 Partition the numbers according to place value.

a 9 145 = ☐ thousands + 1 ☐ + ☐ + ☐ ones

b 8 037 = ☐ thousands + ☐ hundreds + ☐ + ☐ ones

2 Partition the numbers according to digit value.

a 1 056 = 1 000 + ☐ + ☐ + ☐

b 3 429 = ☐ + ☐ + ☐ + ☐

3 Write each number that has been partitioned below.



a 4 thousands + 6 hundreds + 3 tens + 1 ones = 4 631

b 1 000 + 10 + 1 = ☐

c 3 000 + 8 + 10 = ☐

d 9 tens + 5 thousands + 8 hundreds + 0 ones = ☐

e 600 + 2 + 7 000 = ☐