Optical Illusions 2

Watch the video. Number the illusions in the order they appear. Then answer the questions.



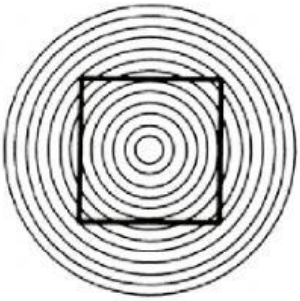



	How many animals can you see in the image?
	Are the orange circles the same size?

	Which two animals can be seen in the picture? A _____ and a _____.
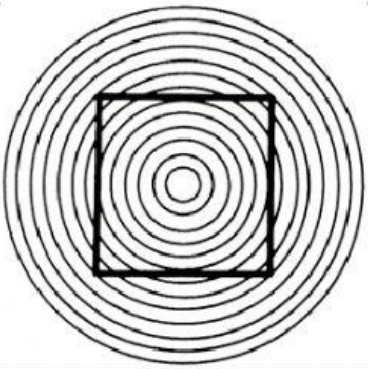	Is the square curved or straight?
	Are the lines parallel?