מתמטיקה

מבדק ב נושה משולש שווה שוקיים כיתה ח.

מצאו את x במשולשים שווה שוקיים הבאים:

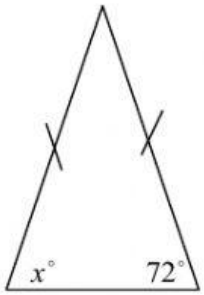

$x =$

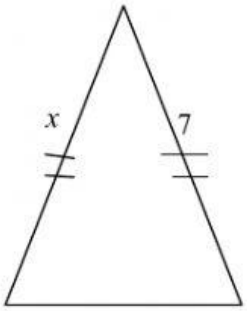

$x =$

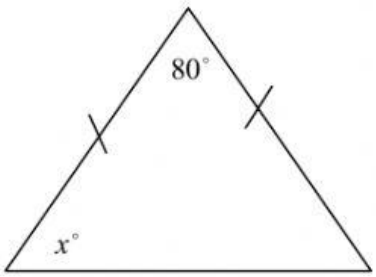

$x =$

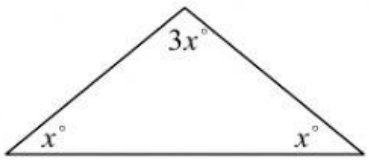

$x =$