Какая часть фигуры закрашена?

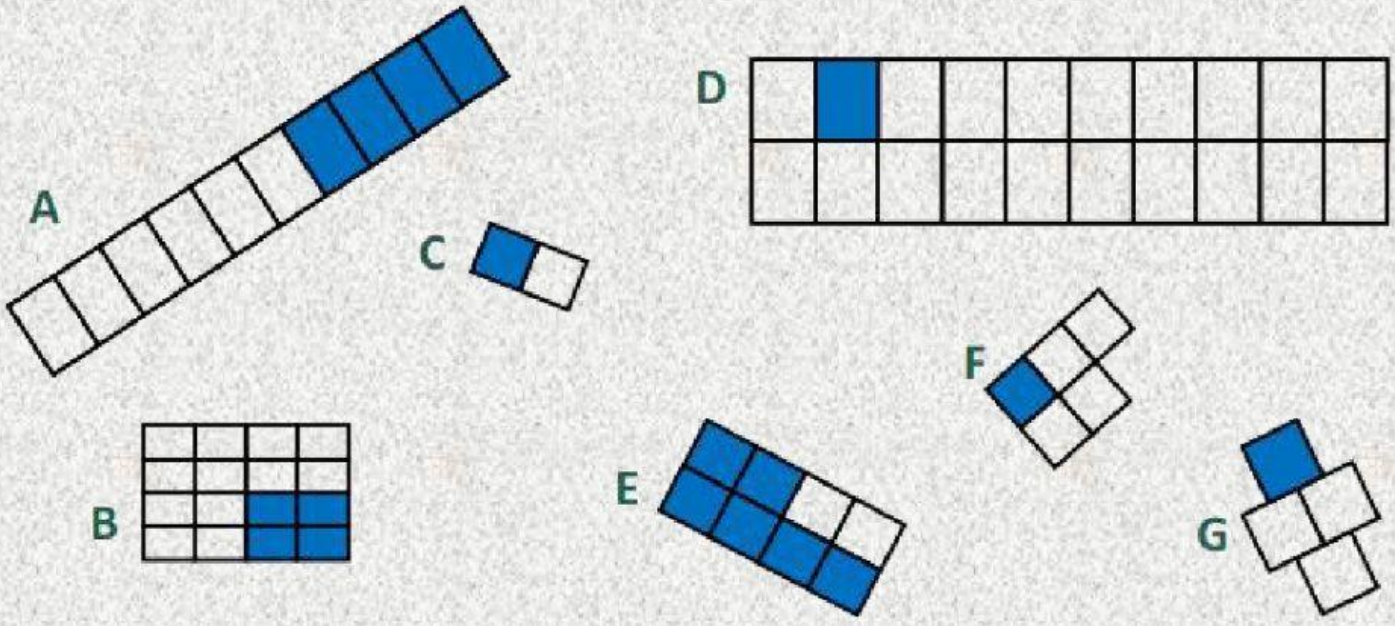





a b c d e

$\frac{\square}{\square}$ $\frac{\square}{\square}$ $\frac{\square}{\square}$ $\frac{\square}{\square}$ $\frac{\square}{\square}$

Запиши дроби и сравни их!

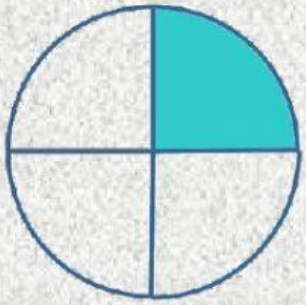

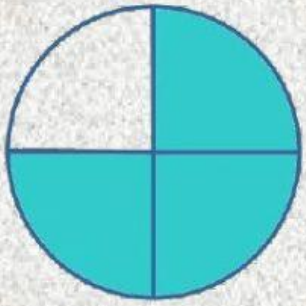

$\frac{\square}{\square} \square \frac{\square}{\square}$

Какая часть торта украшена розочками?

$\frac{\square}{\square}$

На какую часть торта поставили свечи?

$\frac{\square}{\square}$

Сравни эти дроби!

$\frac{\square}{\square} \square \frac{\square}{\square}$

Спасибо за работу!

Larisa Zavoronoka