Name _____

Plate Tectonics

Identify the three types of plate boundaries.

Draw a line to match the name of the boundary to the descriptions.

new crust is generated as the plates pull away from each other	convergent
crust is destroyed as one plate goes underneath the other	transform
crust is neither made or destroyed as two plate pass by each other horizontally	divergent

Write the name of the boundary shown in the diagram.

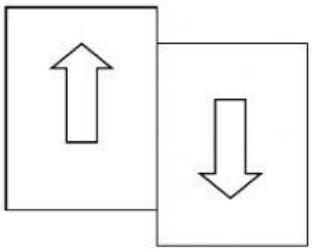

_____

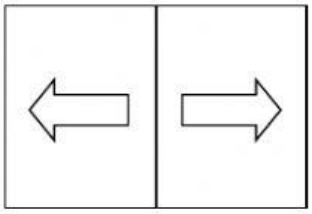

_____

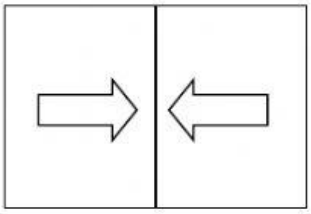

_____