2. EBALUAKETA: MATEMATIKA KONTROLA: NEURRIAK ETA GEOMETRIA

Izen abizenak: _____ **Data:** _____

1. **Aukeratu gorriz markatutako atala irudien oinarria ala altuera den:**

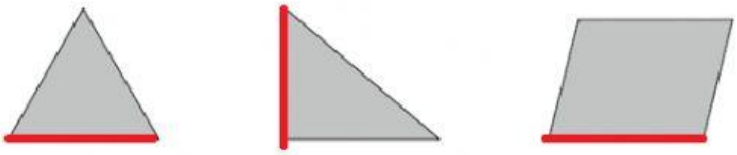

Oinarria Altuera **Oinarria Altuera** **Oinarria Altuera**

2. **Neurtu eta kalkulatu irudi hauen perimetroa eta azalera.**

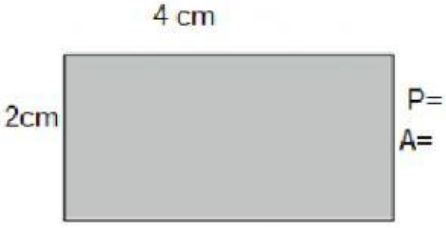

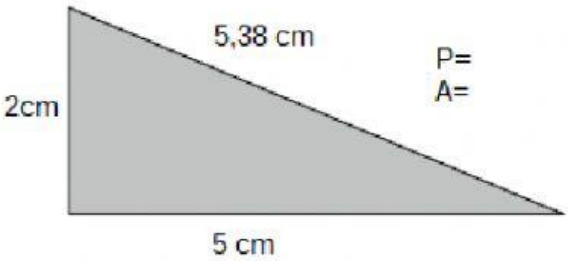

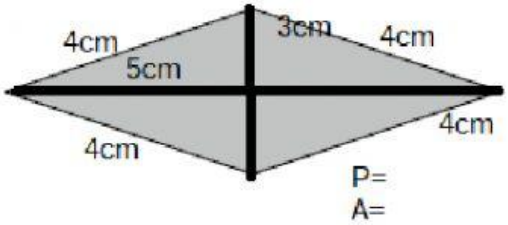

3. **Kalkulatu hexagono erregular baten azalera, kontutan izanda aldea 10 cm dela, eta apotema, 8,7 cm.**

A=

4. **Ordenatu handienetik txikienera neurri multzo bakoitza.**

• 4.000 dl 4,1 hl 4.230 dal 49.000 cl 0,004 kl

_____>_____>_____>_____>_____

• 570.000 cm 5.280 m 534 dam 52 hm 5,6 km

_____>_____>_____>_____>_____

• 98.000 cg 0,9 hg 900.000 mg 99 dag 96 dg

_____>_____>_____>_____>_____

5. **Egin adierazitako neurri aldakteak.**

$6m^2$= _____ dm^2

$2,5\ dm^2$= _____ cm^2

$8,9\ dam^2$= _____ m^2

$3,6\ hm^2$= _____ dam^2

$45.000\ cm^2$= _____ m^2

$8.600\ dm^2$= _____ m^2

$3,9\ m^2$= _____ dam^2

$3.890 dam^2$=_____ hm^2