Name: _____ **Grade/Section:** _____

Independent Practice

Instructions: Look at the groupings below and select the animal that does not belong. Indicate if the selected animal is a **VERTEBRATE** or **INVERTEBRATE** and explain why it does not belong to the group to the space below.

1		
 Cow	Octopus	Horse
VERTBRATE	INVERTEBRATE	

2		
Crab	Spider	Tiger
VERTBRATE	INVERTEBRATE	

3		
Sea Anemones	Goat	Snail
VERTBRATE	INVERTEBRATE	

4		
Scorpion	Goat	Tortoise
VERTBRATE	INVERTEBRATE	

5		
 Elephant	Sheep	 Sea Urchin
VERTBRATE	INVERTEBRATE	