Mathematics

Fifty Family Numbers

A. Type the Fifty family numbers

B. How many tens and ones?

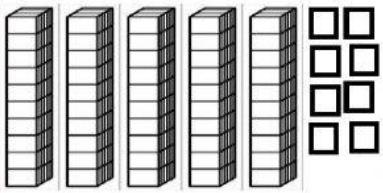

___tens ___ones =_____

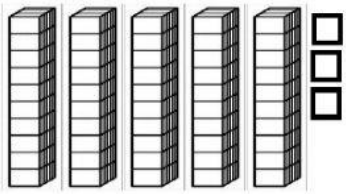

___tens ___ones =_____

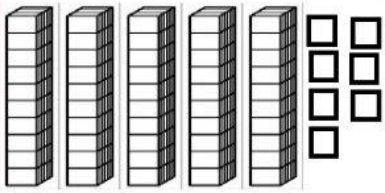

___tens ___ones =_____

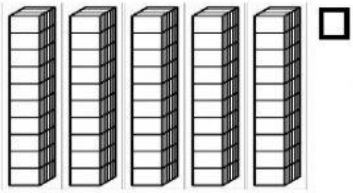

___tens ___ones =_____

C. Fill in the missing number (before, after, between)

D. _____, 51 E. _____, 59 F. _____, 55

G. 58, _____ H. 50, _____ I. 57, _____

J. 54, _____, 56 K. 57, _____, 59 L. 55, _____, 57

Click the greatest (biggest) number in each set.

(M) 58 51 (N) 50 55 (O) 57 56

P. Which number doesn't belong?

59 50 58 51 17 53