	tens	ones
34	3	4
19		
27		
42		
50		
65		
4		
23		



+ = _____ tens + _____ ones

+ = _____ tens + _____ ones

 + = _____ tens + _____ ones

6 tens + 3 ones = _____

5 tens + 1 one = _____

3 tens + 8 ones = _____

9 tens + 7 ones = _____

4 tens + 5 ones = _____

2 tens + 8 ones = _____

Directions: Write the value of each number below.



35 _____ tens _____ ones

19 _____ tens _____ ones

8 _____ tens _____ ones

26 _____ tens _____ ones

49 _____ tens _____ ones

10 _____ tens _____ ones

Directions: Write the number below.

4 tens 6 ones _____

2 tens 9 ones _____

1 ten 4 ones _____

2 tens 1 one _____

3 tens 3 ones _____

3 tens 2 ones _____

4 tens 0 ones _____

0 tens 6 ones _____

4 tens 7 ones _____

1 ten 1 one _____



\+ = 33

3 tens + 3 ones = 33

7 tens + 5 ones = _____

2 tens + 3 ones = _____

5 tens + 2 ones = _____

5 tens + 4 ones = _____

9 tens + 5 ones = _____

4 tens + 0 ones = _____

8 tens + 1 one = _____

1 ten + 1 one = _____

6 tens + 3 ones = _____

3 tens + 7 ones = _____

Directions: Draw a line to the correct number.

6 tens + 7 ones	*Example:*	73
4 tens + 2 ones		67
8 tens + 0 ones		51
7 tens + 3 ones		80
5 tens + 1 one		42

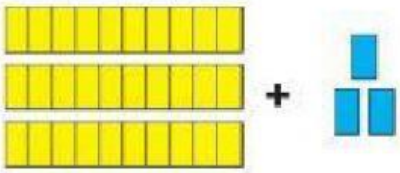

+ = _____ tens + ____ ones

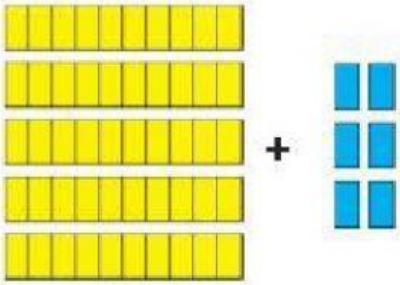

+ = _____ tens + ____ ones

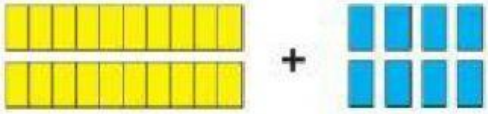

+ = _____ tens + ____ ones

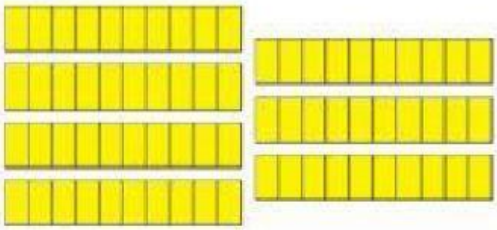

+ = _____ tens + ____ ones

	tens	ones		
3 tens, 2 ones	3	2	=	32
3 tens, 7 ones	____	____	=	____
9 tens, 1 ones	____	____	=	____
5 tens, 6 ones	____	____	=	____
6 tens, 5 ones	____	____	=	____
6 tens, 8 ones	____	____	=	____
2 tens, 8 ones	____	____	=	____
4 tens, 9 ones	____	____	=	____
1 ten, 4 ones	____	____	=	____
8 tens, 2 ones	____	____	=	____
4 tens, 2 ones	____	____	=	____

28 = ____ tens, ____ ones
64 = ____ tens, ____ ones
56 = ____ tens, ____ ones
72 = ____ tens, ____ ones
38 = ____ tens, ____ ones
17 = ____ ten, ____ ones
63 = ____ tens, ____ ones
12 = ____ ten, ____ ones

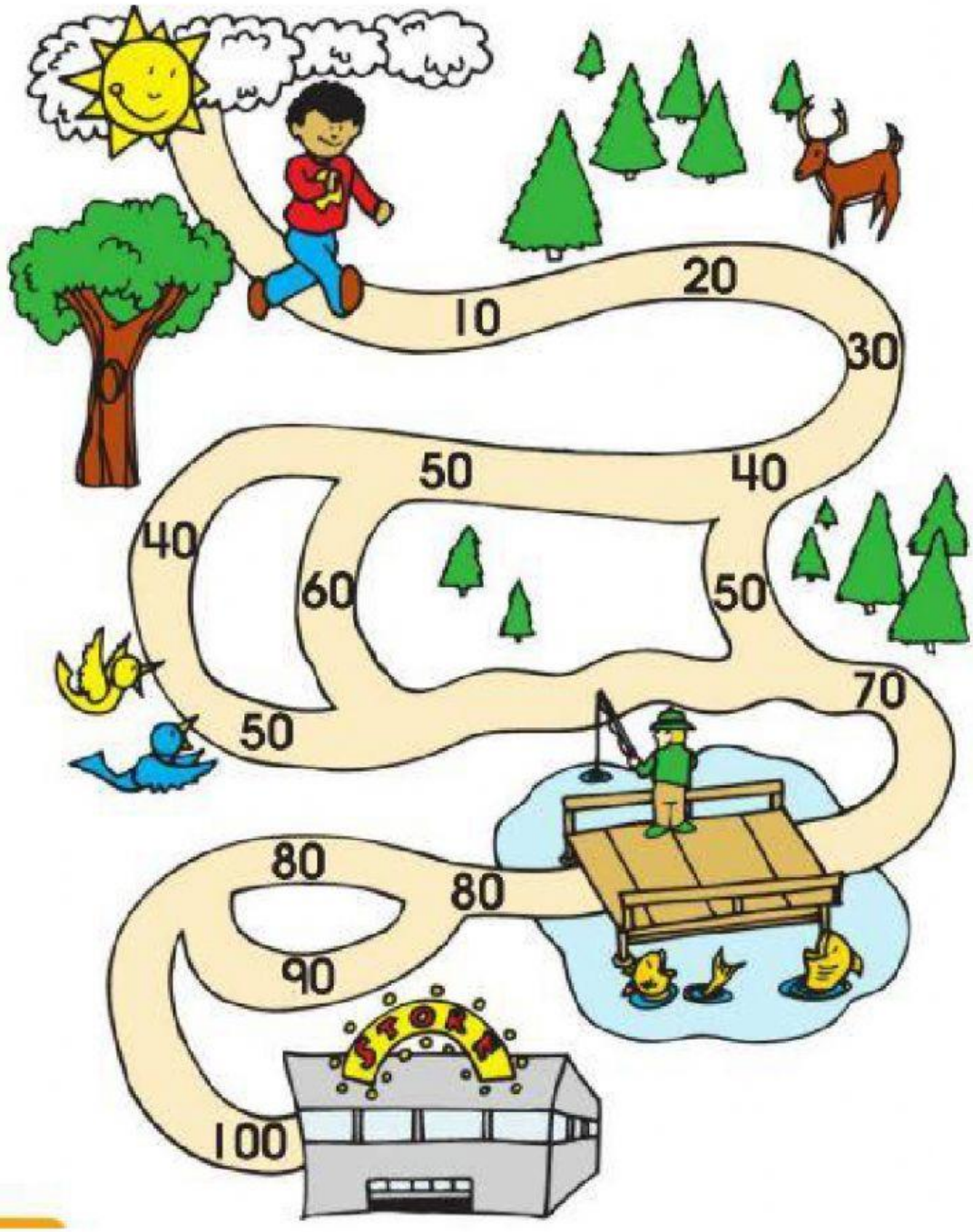
10
20
30
40
50
40
60
50
70
50
80
80
90
100
STORE

Directions: Use the groups of 10s to count to 100.

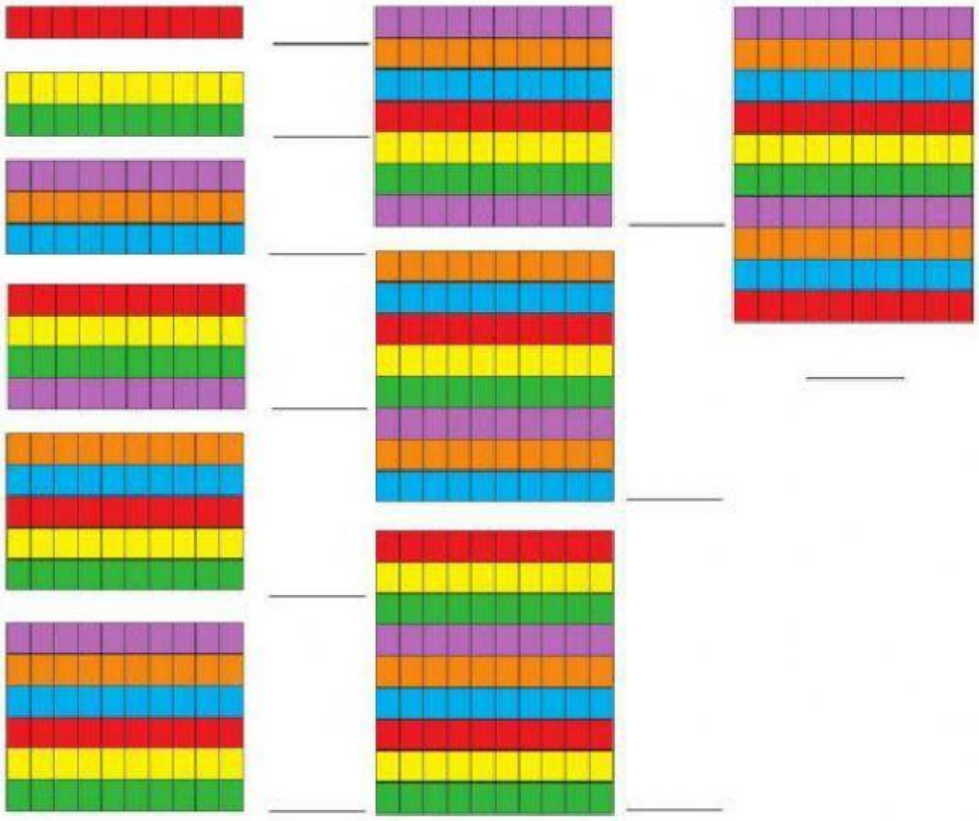

Subtracting Tens

Examples:

6 tens	60	8 tens	80
− 3 tens	−30	− 2 tens	−20
3 tens	30	6 tens	60

Directions: Subtract.

7 tens	70		11 tens	110
− 5 tens	−50		− 2 tens	−20
tens			tens	
50	60	20	80	40
−30	−20	−10	−40	−40
90	80	70	30	50
−50	−20	−30	−20	−40
60	40	80	90	70
−30	−10	−30	−20	−50
80	90	70	60	50
−70	−80	−40	−40	−20