Can you identify the 2 D shapes?

Drag the name to match the shapes.







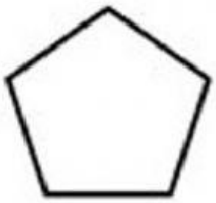

square

trapezoid

rectangle

octagon

parallelogram

pentagon

triangle

rhombus

hexagon

Identifying the Name of Shapes

Directions: Choose the correct name for each shape below.

1.



- ○ square
- ○ rhombus
- ○ rectangle

2.



- ○ square
- ○ rectangle
- ○ cube

3.

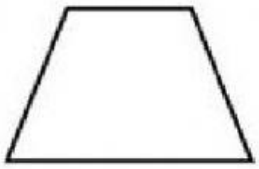

- ○ trapezoid
- ○ rhombus
- ○ rectangle

4.



- ○ circle
- ○ cube
- ○ rectangle

5.

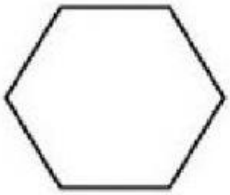

- ○ pentagon
- ○ hexagon
- ○ square

6.

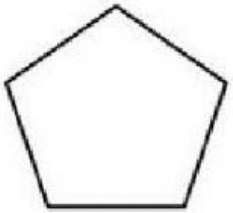

- ○ octagon
- ○ rhombus
- ○ pentagon

7.

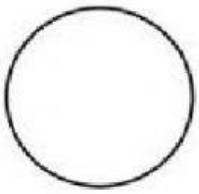

- ○ square
- ○ circle
- ○ cylinder

8.

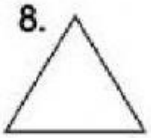

- ○ cone
- ○ triangle
- ○ cube

9.

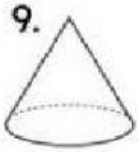

- ○ cone
- ○ triangle
- ○ cube

10.

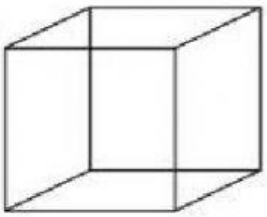

- ○ square
- ○ cube
- ○ trapezoid