Number 2

How many fingers are being shown

1 3 2

How many hearts can you see?

2 1 3

How many elephants can you see?



3 1 2

How many pencils can you see?



3 2 1

Scanned with CamScanner

Tick 2 stars

Find a select the number 2

1	2	5	2
2	0	2	7
6	2	1	2

Select the box with 2 images





Scanned with CamScanner