Area and Circumference of Circles

Round each answer to the nearest tenth.

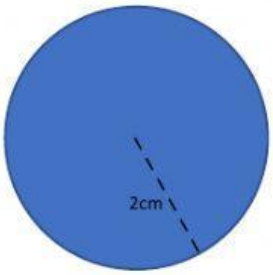

Circumference: _____ cm

Area: _____ cm^2

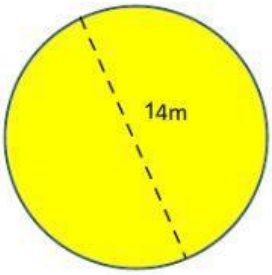

Circumference: _____ m

Area: _____ m^2



Circumference: _____ m

Area: _____ m^2

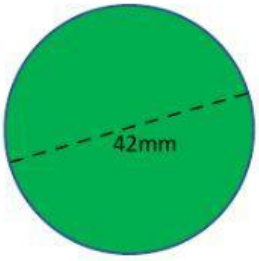

Circumference: _____ mm

Area: _____ mm^2

Circumference: _____ mm

Area: _____ mm^2

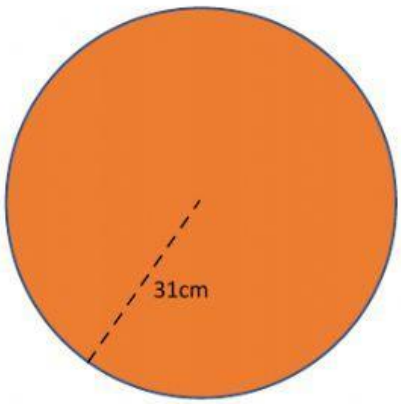

Circumference: _____ cm

Area: _____ cm^2