LATIHAN PENGUKUHAN TOPIK 1.1

1. Namakan pengelasan bagi mikrorganisma di bawah:

(a)

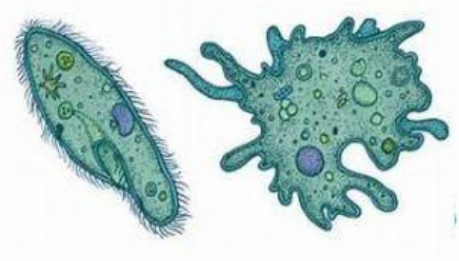

(b)

(c)

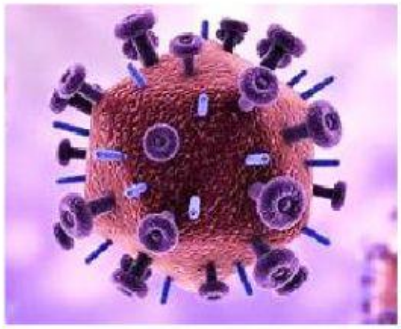

(d)

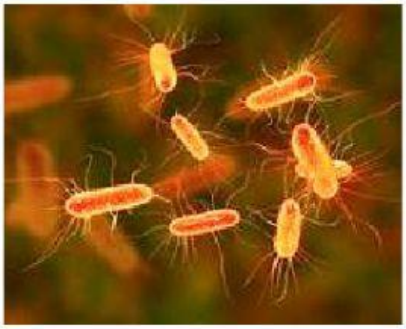

(e)



2. Nyatakan cara pembiakan bagi mikroorganisma berikut:

(a)

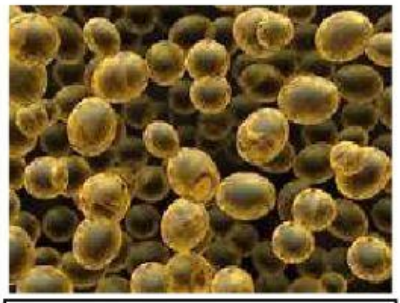

(b)

(c)

3. Nyatakan cara mikroorganisma berikut memperoleh nutrisi

(a)

(b)