Lembar Kerja Peserta Didik

(LKPD)

Nama : **Kelas : 4C**

Tujuan Pembelajaran : Membulatkan hasil pengukuran berat

Tulis hasil pembulatannya(angka saja)!

1. Tentukan berat benda berikut dengan pembulatan ke kg terdekat.

a.

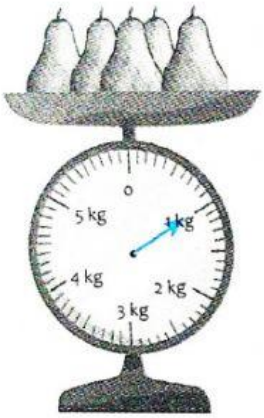

Sumber: *Dokumen Penerbit*

Berat avokad sekitar ... kg.

c.



Sumber: *Dokumen Penerbit*

Berat pepaya sekitar ... kg.

e.

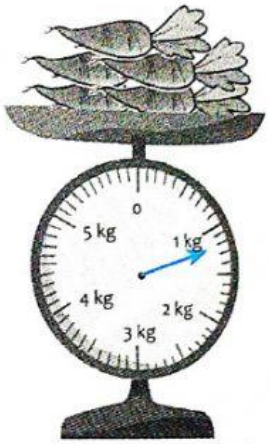

Sumber: *Dokumen Penerbit*

Berat wortel sekitar ... kg.

b.

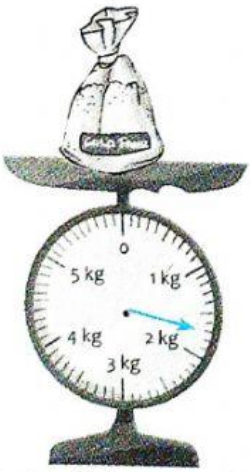

Sumber: *Dokumen Penerbit*

Berat gula pasir sekitar ... kg.

d.

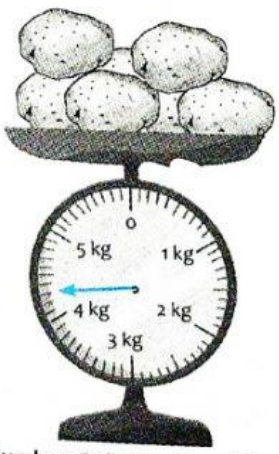

Sumber: *Dokumen Penerbit*

Berat kentang sekitar ... kg.

f.



Sumber: *Dokumen Penerbit*

Berat mangga sekitar ... kg.