Realiza las siguientes sumas y escribe su resultado.



D	U
	3
+	1



D	U
	2
+	2



D	U
	4
+	2

D	U
	5
+	3

D	U
	7
+	1



D	U
	6
+	2

D	U
	5
+	4



D	U
	8
+	1