Cuantos cubos hay en cada figura:(recuerda contar la base, el fondo y la altura)

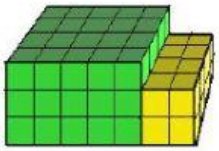





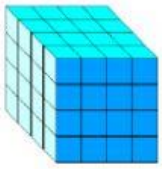

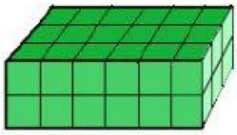

Halla el volumen de un cubo de 3m de arista

La formula es: base x altura x profundidad

Completa:

5 m= cm; 43dm = mm; 53mm = dm

66dam = dm; 450 hm = kn 27 km = cm

3 m^2 = dm^2; 3 km^2 = m^2; 5cm^2= m^2

78000 cm^2= cm^2; 20400 m^2 = km^2 ; 500000 hm^2 km^2

¿Pasa a segundos?

12h = 43 minutos = 38 minutos = 1 día =

Suma o resta.

24 h	33´	44"	33º	4´	56"	4 h	32´	53"	67º	46´	28"
+ 5 h	22´	33"	+ 7º	15´	28"	- 2 h	50´	32"	- 43º	48´	32"

LIVEWORKSHEETS