Lembar Kegiatan Siswa

MATEMATIKA

Bangun Ruang

Nama : _____

Nomor Absen : _____

==========

Amati Gambar Bangun Ruang Berikut!
Isilah tabel banyaknya komponen bangun ruang tersebut dengan benar!

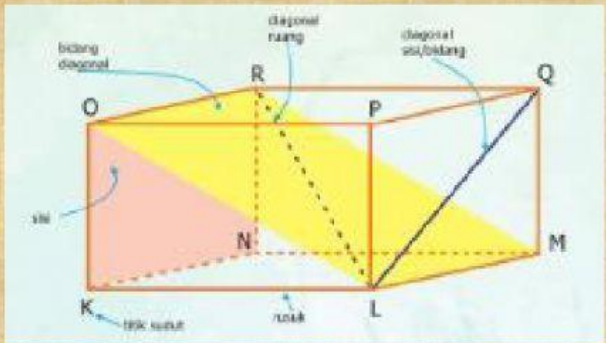

Nama Bangun Ruang: .....

No.	Komponen	Banyaknya
1	Rusuk	
2	Sisi	
3	Titik sudut	
4	Diagonal sisi atau diagonal bidang	
5	Diagonal ruang	
6	Bidang diagonal	

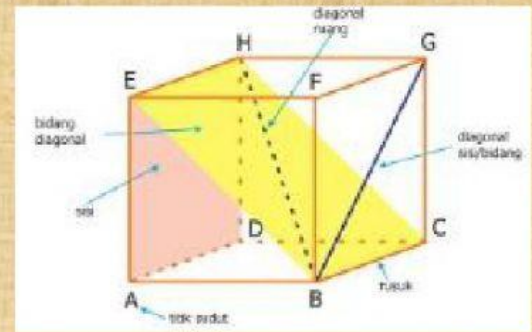

Nama Bangun Ruang: .....

No.	Komponen	Banyaknya
1	Rusuk	
2	Sisi	
3	Titik sudut	
4	Diagonal sisi atau diagonal bidang	
5	Diagonal ruang	
6	Bidang diagonal	

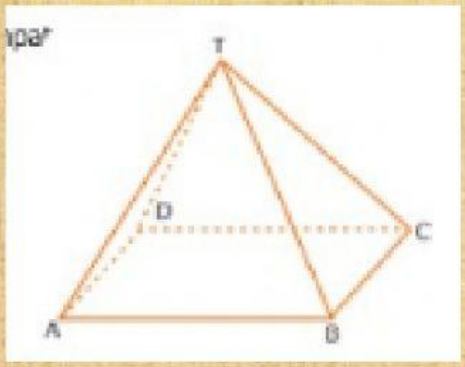

Nama Bangun Ruang: .....

No.	Komponen	Banyaknya
1	Rusuk	
2	Sisi	
3	Titik sudut	
4	Diagonal sisi atau diagonal bidang	

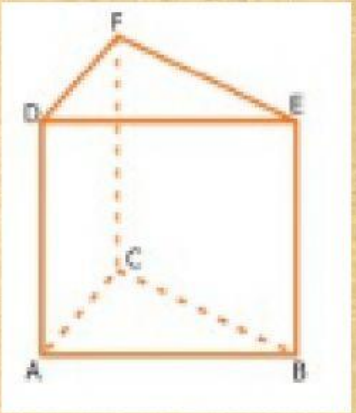

Nama Bangun Ruang: .....

No.	Komponen	Banyaknya
1	Rusuk	
2	Sisi	
3	Titik sudut	
4	Diagonal sisi atau diagonal bidang	

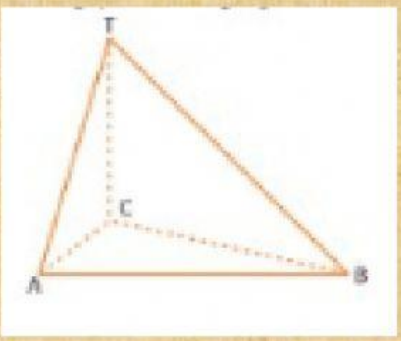

Nama Bangun Ruang: .....

No.	Komponen	Banyaknya
1	Rusuk	
2	Sisi	
3	Titik sudut	

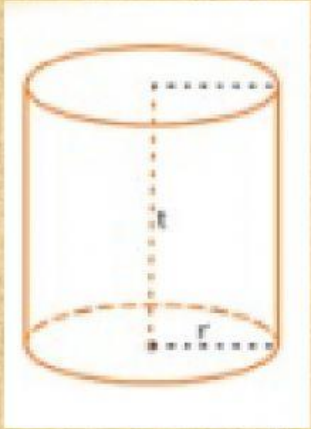

Nama Bangun Ruang: .....

No.	Komponen	Banyaknya
1	Rusuk	
2	Sisi	
3	Titik sudut	

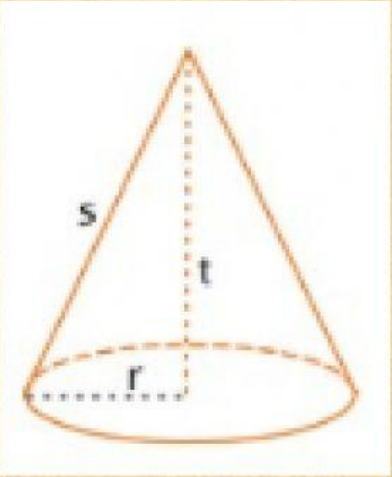

Nama Bangun Ruang: .....

No.	Komponen	Banyaknya
1	Rusuk	
2	Sisi	
3	Titik sudut	